ACTIVIDADES INTERACTIVAS

Estudiante: TAMARA BAÑO



LIVEWORKSHEETS

OBSERVE Y SELECCIONE EL NÚMERO DE UNIDADES CÚBICAS DE CADA FIGURA

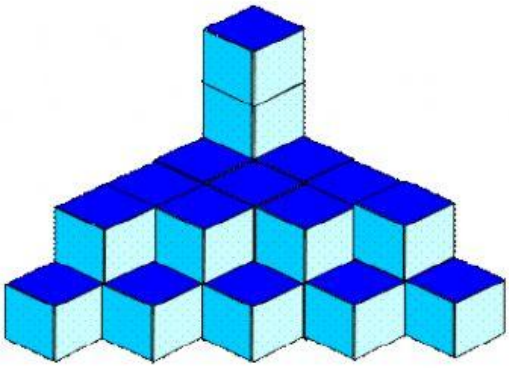

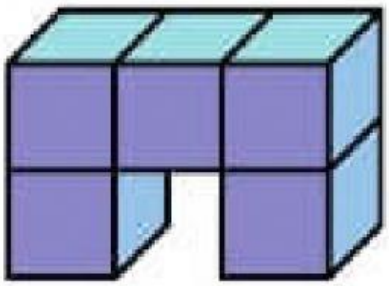

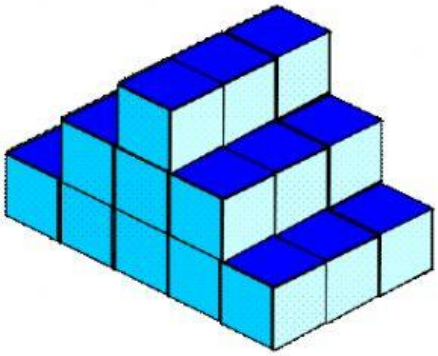

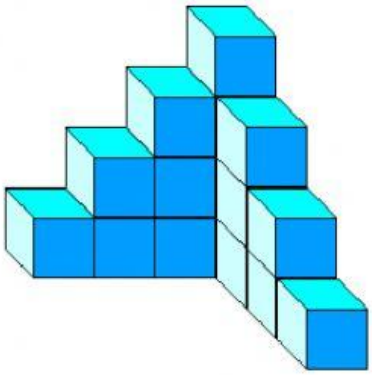

LIVEWORKSHEETS

ORDENE LAS FIGURAS DE MAYOR A MENOR PESO, PONIENDO DEBAJO DE CADA NÚMERO DESDE 1 PARA EL MAYOR HASTA 5 PARA EL MENOR

1	2	3	4	5

1	2	3	4	5

LIVEWORKSHEETS

ESCRIBE LOS NÚMERO CORRECTOS EN LOS ESPACIOS EN BLANCO PARA COMPLETAR LAS SERIES

1	5		9	11	

2	4			10	12

22		26		30

LIVEWORKSHEETS