Tarikh: 23 Jun 2021

Matematik Awal: Operasi Tambah.

Tonton Video Ini.

LIVEWORKSHEETS

Nama:

Kelas: Prasekolah Tunas Gemilang.

Tambahkan.

Afnan membeli 5 biji bola.
Aatif membeli 3 biji bola lagi.
Berapa biji bola Afnan dan Aatif?



Aisya ada 1 topeng badut.
Afza juga ada 1 topeng badut.
Berapa topeng badut mereka ?



Daris ada 2 biji belon.
Ibu beri 2 biji belon lagi.
Berapa belon Daris ?



LIVEWORKSHEETS

Thaqif ada 5 buah buku.
Muizz ada 5 buah buku
Berapa buah buku mereka?

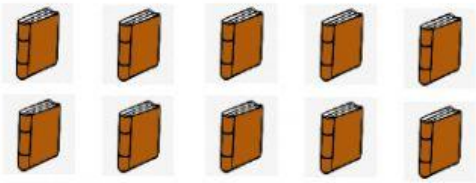

☐ + ☐ = ☐

Azeem ada 6 biji cawan.
Ammar ada 6 biji cawan.
Berapa biji cawan mereka?

☐ + ☐ = ☐

Adam ada 4 biji terung.
Ibu beri 2 biji terung lagi.
Berapa terung Adam?



☐ + ☐ = ☐

LIVEWORKSHEETS