**Name:**_____ **Date:**_____

## Standard 2 End of Term Test.

## Mathematics

**1.** What is the time shown on the analog clock below?

_____

**2.** What is the digital time shown on the clock below?

_____

LIVEWORKSHEETS

# MARCH 2020

| Sunday | Monday | Tuesday | Wednesday | Thursday | Friday | Saturday |
|---|---|---|---|---|---|---|
| 1 | 2 | 3 | 4 | 5 | 6 | 7 |
| 8 | 9 | 10 | 11 | 12 | 13 | 14 |
| 15 | 16 | 17 | 18 | 19 | 20 | 21 |
| 22 | 23 | 24 | 25 | 26 | 27 | 28 |
| 29 | 30 | 31 | | | | |

**Use the calendar above to help you answer the following questions.**

**3.** How many days are there in March?_____

**4.** What day of the week is March 18th?_____

**5.** How many Mondays are there in March? _____

LIVEWORKSHEETS

**6.** Calculate the area of the square below using the formula
Area of square= **S x S.**

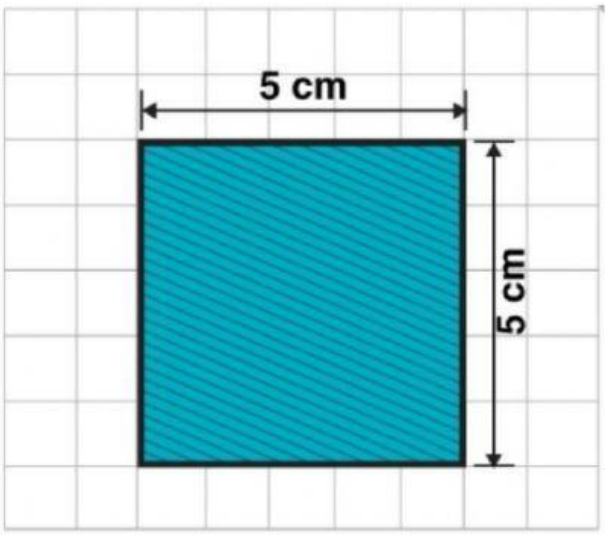


_____

**7.** Calculate the area of the rectangle below using the formula
Area of rectangle = **L x B**

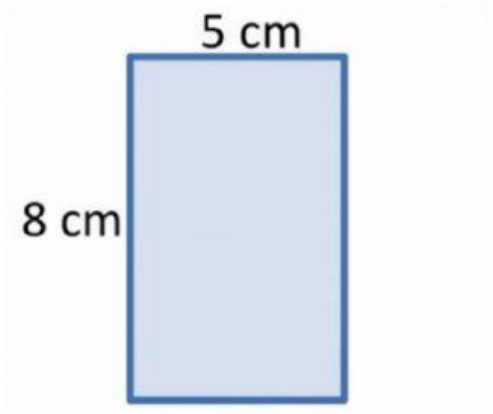


_____

LIVEWORKSHEETS

**8.** Calculate the perimeter of the square below using the formula
Perimeter of square = **S+S+S+S**

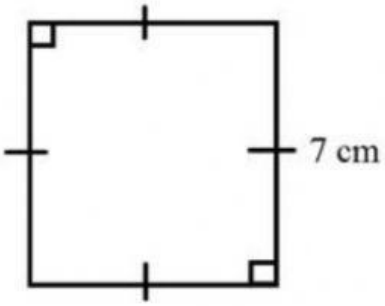


_____

**9.** Calculate the perimeter of the rectangle below using the formula

Perimeter of rectangle = **(L+B)×2**




_____

LIVEWORKSHEETS

**10.** Find the Mode in the set of numbers below .

**1,2,3,1,4,5,6,3,4,2,5,4**

**Put an x in the box for the correct answer.**

**a. 2 □ b. 3 □ c. 4 □ d. 5□**

**11.** Find the Mean or Average of the set of numbers below.

**1,2,2,3,1,5,6,3,2,5**

**Put an x in the box for the correct answer .**

**a. 4 □ b. 3 □ c. 2 □ d. 1 □**

LIVEWORKSHEETS

# TALLY CHART AND FREQUENCY TABLE

Laila is a café owner. She sells burger, pizza, hot dog and fried chicken. The tally chart shows how many of each kind were sold during the weekends. Use the information from the tally chart to answer the questions. Write the frequency of the items sold in the table given. One has been done for you.

| Food Items | Tally Marks | Frequency |
|---|---|---|
| Burger | 𝍸 𝍸 𝍸 I | 16 |
| Pizza | 𝍸 𝍸 𝍸 𝍸 IIII | 24 |
| Fried Chicken | 𝍸 𝍸 II | 12 |
| Hot Dog | 𝍸 III | 8 |

**Study the information provided on the tally chart and frequency table above then answer the questions below.**

**12.** Which food item was sold the most? _____.

**13.** How many food items were sold altogether?_____.

**14.** How many more pizzas were sold than hotdogs?_____.

LIVEWORKSHEETS

Steven, Gloria, Andrew and Jessica received Christmas gifts from Santa Claus. Use the pictograph to answer the questions.

| Christmas Gifts | |
|---|---|
| Name | Number of Gifts |
| Steven | |
| Gloria | 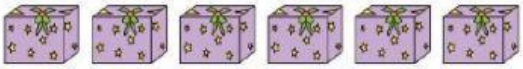 |
| Andrew | 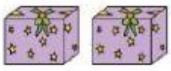 |
| Jessica | 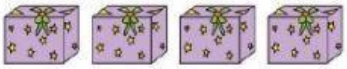 |

**Key**

= 2 Gifts

**Study the Pictograph above then choose the correct answer below.**

**15.** How many gift are there in total?

**Put an x in the box for the correct answer.**

**a. 20** □ **b. 21** □ **c. 16** □ **d. 15** □

**16.** How many more gifts did Seven get than Andrew?

**Put an x in the box for the correct answer.**

**a. 5** □ **b. 4** □ **c. 2** □ **d. 3** □

LIVEWORKSHEETS

Study the bar graph. Use the information from the graph to answer the questions below.

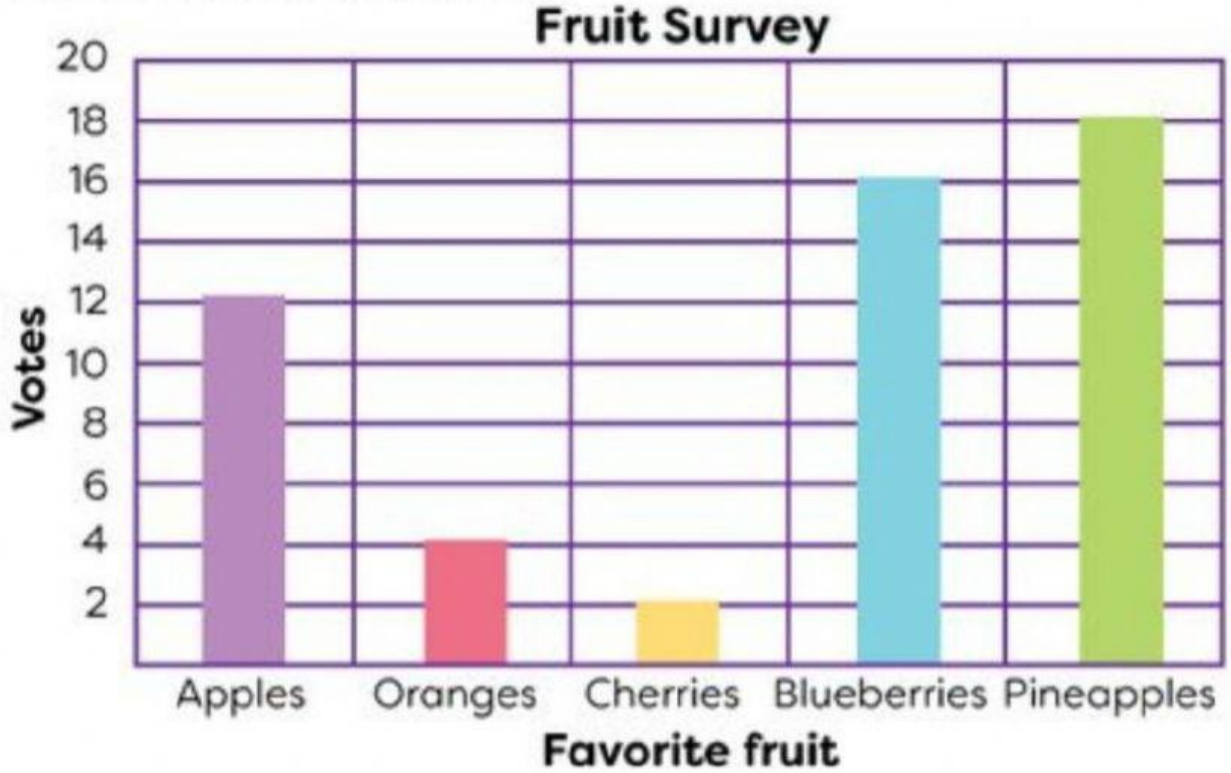


**Study the bar graph above then answer the questions below.**

**17.**Which fruit got the most votes? _____

**18.**How many more votes did apples get than oranges? _____

LIVEWORKSHEETS