Nama :

Operasi Tolak

Lengkapkan ayat matematik berikut.

1.



4 − 1 = 3

2.

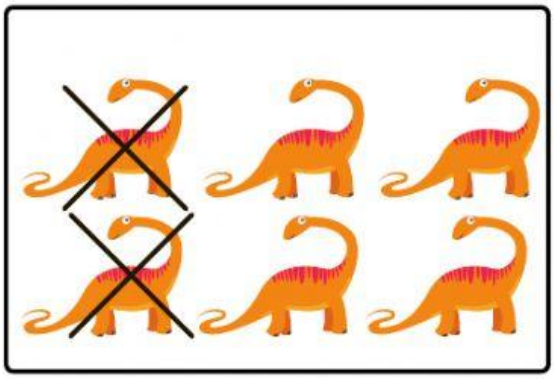

☐ − ☐ = ☐

3.

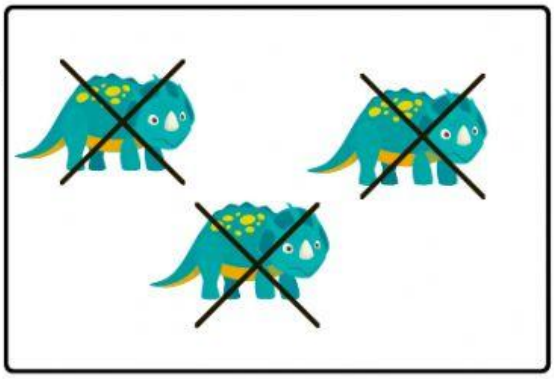

☐ − ☐ = ☐

LIVEWORKSHEETS

Nama :

Operasi Tolak

Lengkapkan ayat matematik berikut.

4.



☐ − ☐ = ☐

5.

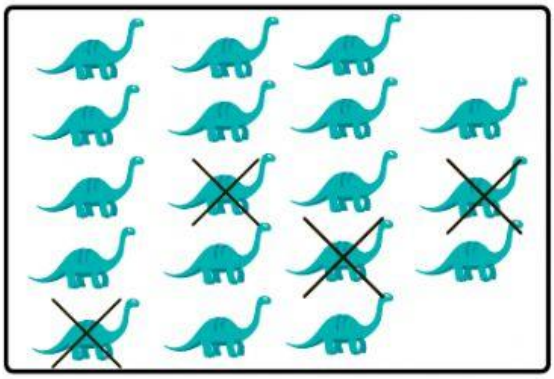

☐ − ☐ = ☐

6.



☐ − ☐ = ☐

LIVEWORKSHEETS