1. Count and write the number.





2. Solve the following additions

10 + 6 = ____

9 + 9 = ____

9 + 8 = ____

LIVEWORKSHEETS

3. Observe each group. Count and write the number of items in the square.

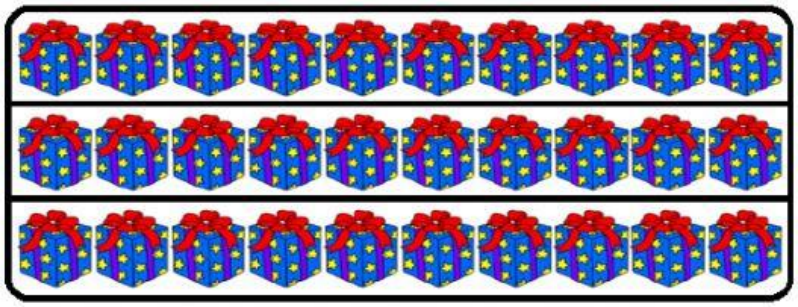

3 tens = ☐ items.



7 tens = ☐ items.

4. Solve the additions and subtractions

$$\begin{array}{r} 90 \\ +\ 10 \\ \hline \end{array} \qquad \begin{array}{r} 60 \\ -\ 40 \\ \hline \end{array} \qquad \begin{array}{r} 50 \\ +\ 50 \\ \hline \end{array} \qquad \begin{array}{r} 90 \\ -\ 30 \\ \hline \end{array}$$

LIVEWORKSHEETS