Q 11. Choose the properties of 3D shapes such as faces and corner

A sphere has _____ face

It has _____ corner

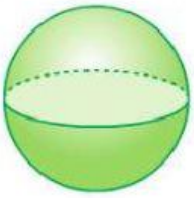

A cube has _____ face

It has _____ corner

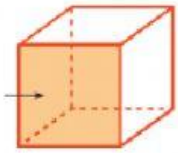

A cylinder has _____ face

It has _____ corner

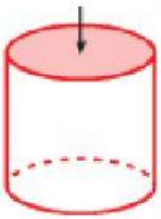

Recognize drag and drop the repeating patterns with shapes

What comes next ?

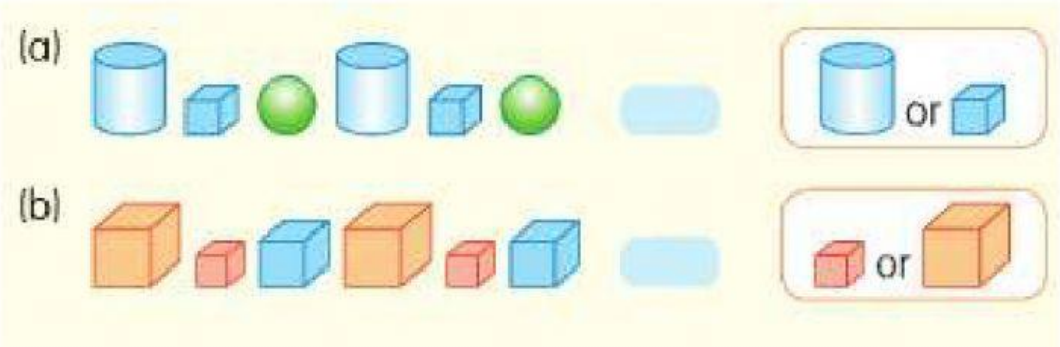

LIVEWORKSHEETS

Q 12. Measure and compare length and mass using nonstandard units

Write the correct option

a) The fish is _____ unit long



b)

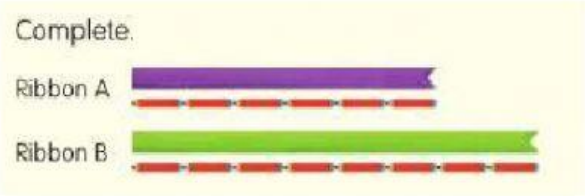

- Ribbon A is _____ long.
- Ribbon B is _____
- Ribbon _____is longer than ribbon _____.

c)

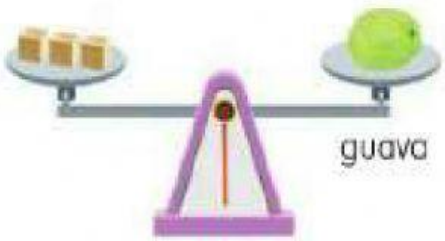

The guava is as heavy as _____.

LIVEWORKSHEETS

d)

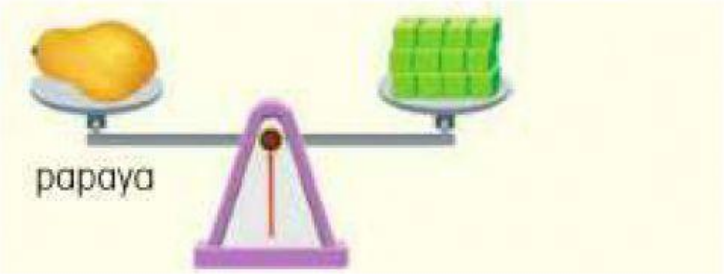

The mass of the papaya is _____ units.

_____ is the lightest

_____ it the heaviest

Q 13. Compare, describe and solve practical problems for capacity

Write the correct option

The pail can fill up _____ bottles of water.

The capacity of the container is _____ glass of units.

LIVEWORKSHEETS

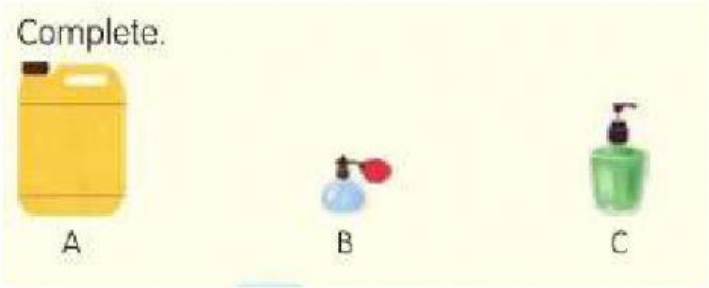

Container _____ has larger capacity than container C.

Container _____has a smaller capacity than container C.

Container _____ has the largest capacity.

Container _____ has the smallest capacity.

Q 14. Read the information shared

a) Write and complete the pictogram



_____children like apple.

_____children like orange.

_____ children like pear.

The most number of children likes _____ fruit.

The least number of children likes _____ fruit.

LIVEWORKSHEETS

b) Make a block/ bar graph of following information.

Count and Tick the blocks for the given shapes

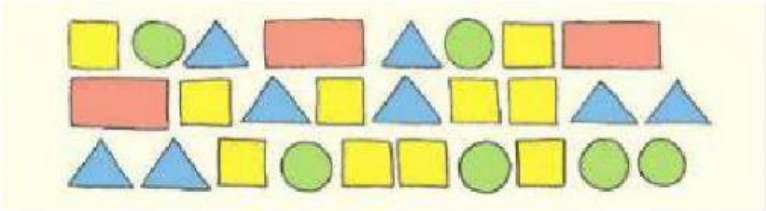



LIVEWORKSHEETS

Q 15 list Carroll and Venn diagrams to group objects

Drag and drop the shape in correct column

a) Sort these shapes in the Carroll diagram.

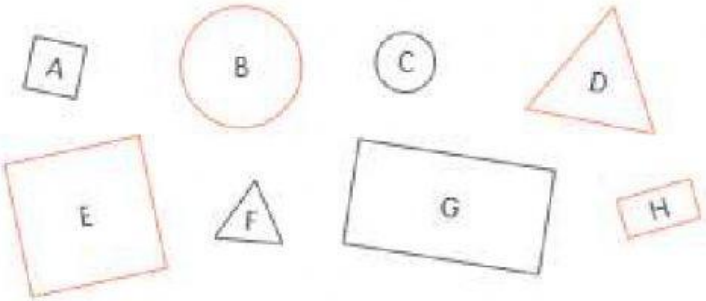

Big	Small
square	square
rectangle	rectangle
circle	circle
triangle	triangle

LIVEWORKSHEETS

LIVEWORKSHEETS

b) Sort these shapes in the Venn diagram

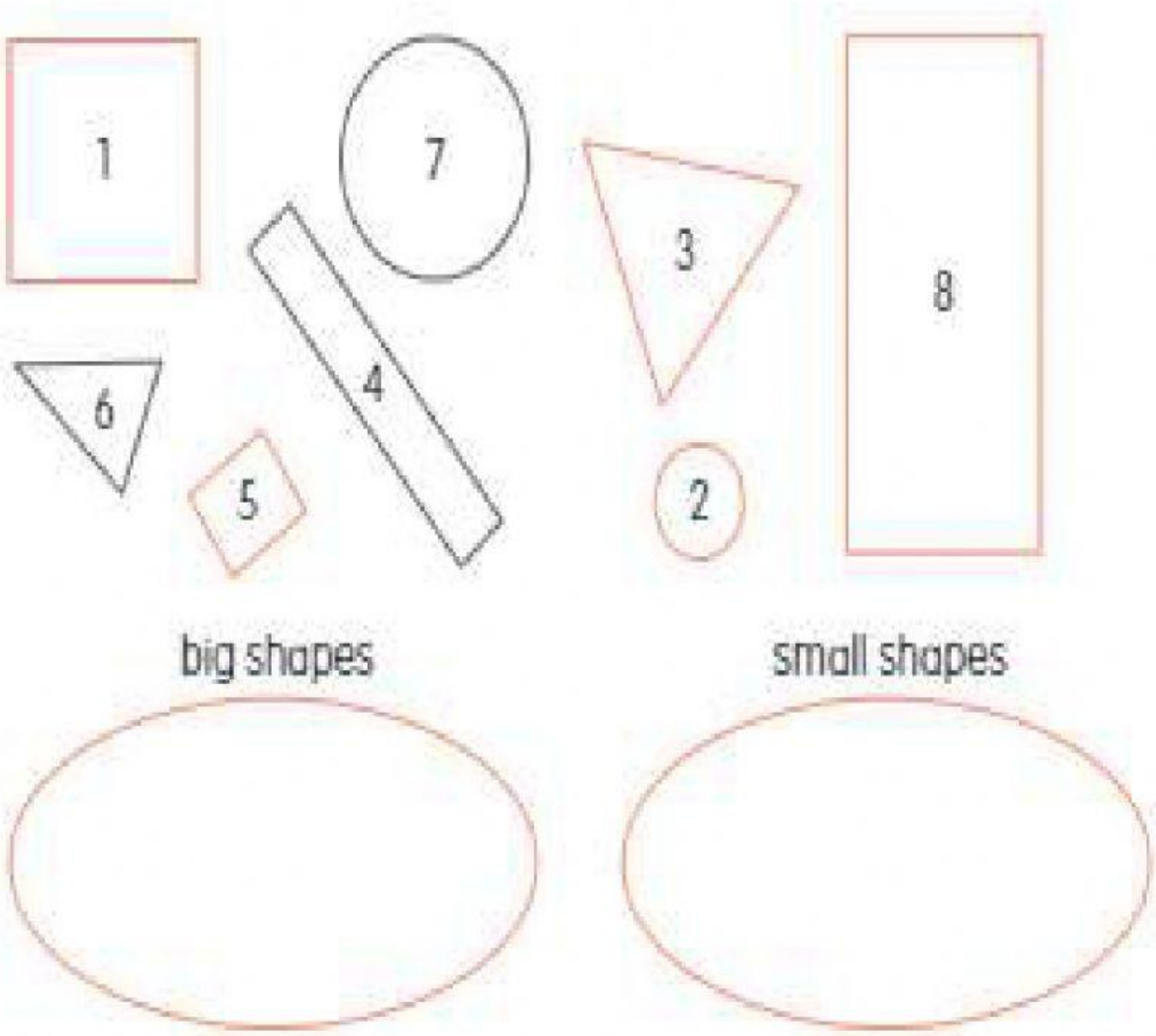

LIVEWORKSHEETS