Matematik Tahun 2 - Darab

Nama: ..... Kelas: .....

1.

Ada ☐ kumpulan 2 gula-gula.

2 + 2 + 2 = 6

☐ x 2 = 6

2.

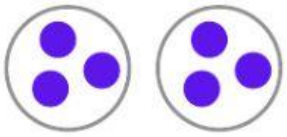

Ada ☐ kumpulan 3 titik biru.

3 + 3 = 6

☐ x 3 = 6

☐ x 2 = ☐ x 3

3.



Ada ☐ kumpulan 3 botol air.

3 + 3 + 3 + 3 = ☐

☐ x 3 = ☐

4.



Ada ☐ kumpulan 2 gula-gula.

2 + 2 + 2 + 2 + 2 = ☐

☐ x 2 = ☐

5.

Ada ☐ kumpulan ☐ titik biru.

☐ + ☐ + ☐ = ☐

☐ x ☐ = ☐

6.

Ada ☐ kumpulan ☐ aiskrim.

☐ + ☐ + ☐ = ☐

☐ x ☐ = ☐

7.

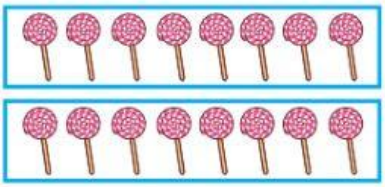

Ada ☐ kumpulan ☐ lolipop.

☐ + ☐ = ☐

☐ x ☐ = ☐

8.

Ada ☐ kumpulan ☐ buku.

☐ + ☐ + ☐ + ☐ + ☐ + ☐ = ☐

☐ x ☐ = ☐

Cikgu Hasmawi

LIVEWORKSHEETS