1. **Identifica si es una función**

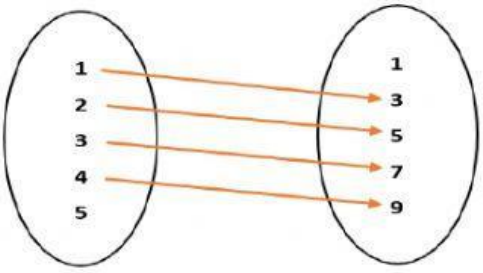

No es una función	Si es una función

2. **¿Qué tipo de función es?**

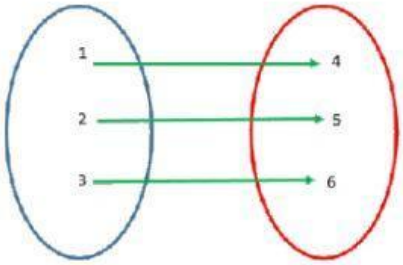

n	F(n)
1	4
2	5
3	6

Función real	Función lineal

3. **Resuelve las siguientes funciones.**

$f(a) = a + 2$

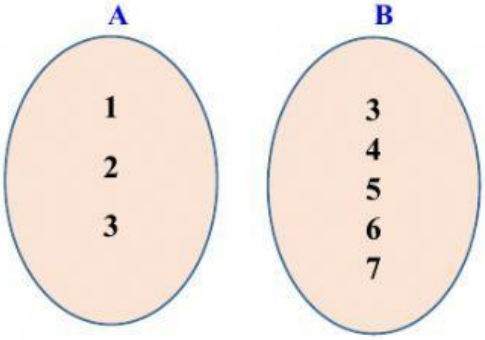

a	f(a)

$y = f(x)^3$

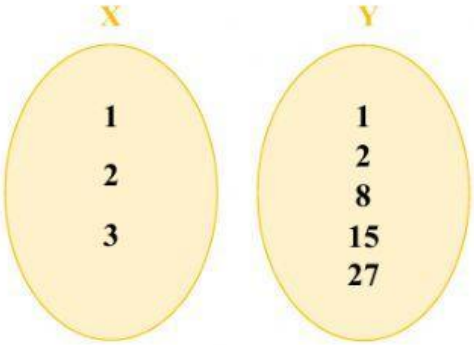

x	f(x)

LIVEWORKSHEETS