**1** Nyatakan skala yang digunakan pada paksi mengufuk dan paksi mencancang dalam setiap satah yang berikut.

(a)

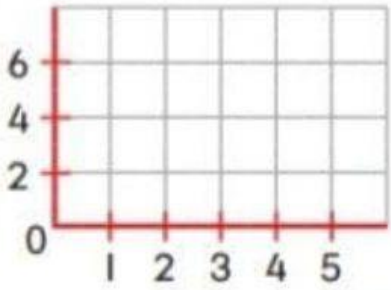


Paksi mengufuk

Paksi mencancang

(b)

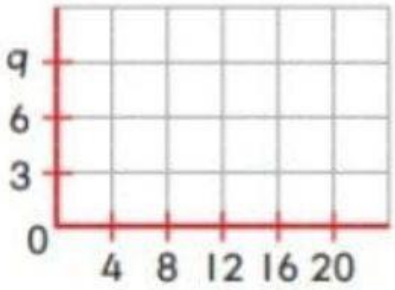


Paksi mengufuk

Paksi mencancang

**2** Tandakan nilai pada kedua-dua paksi.

(a)

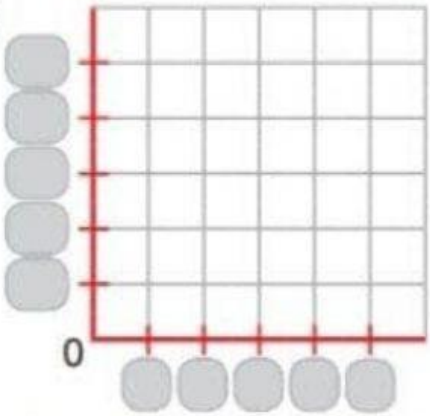


Skala paksi mengufuk 1 : 1.

Skala paksi mencancang 1 : 3.

(b)

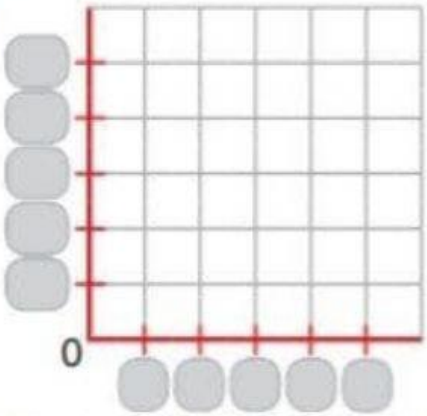


Skala paksi mengufuk 1 : 2.

Skala paksi mencancang 1 : 4.

LIVEWORKSHEETS