Plano cartesiano

1. Observe o plano cartesiano e complete com os pares ordenados

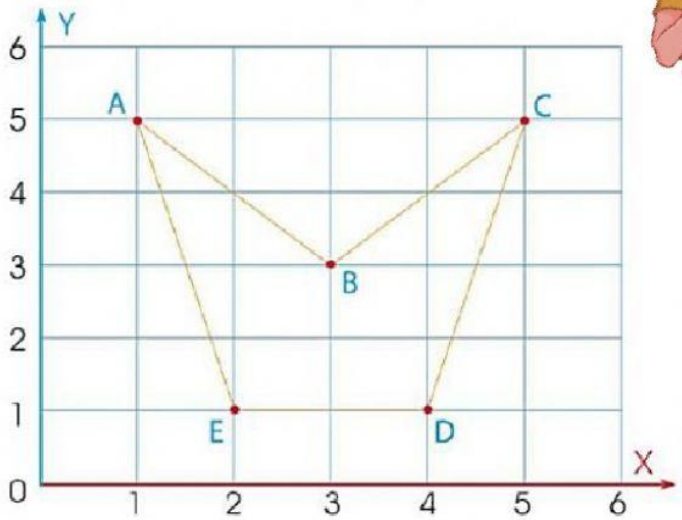

	Par ordenado
A	(;)
B	(;)
C	(;)
D	(;)
E	(;)

2. Através dos coordenadas, descubra o que está escrito escrevendo cada letra nos pares ordenados abaixo.

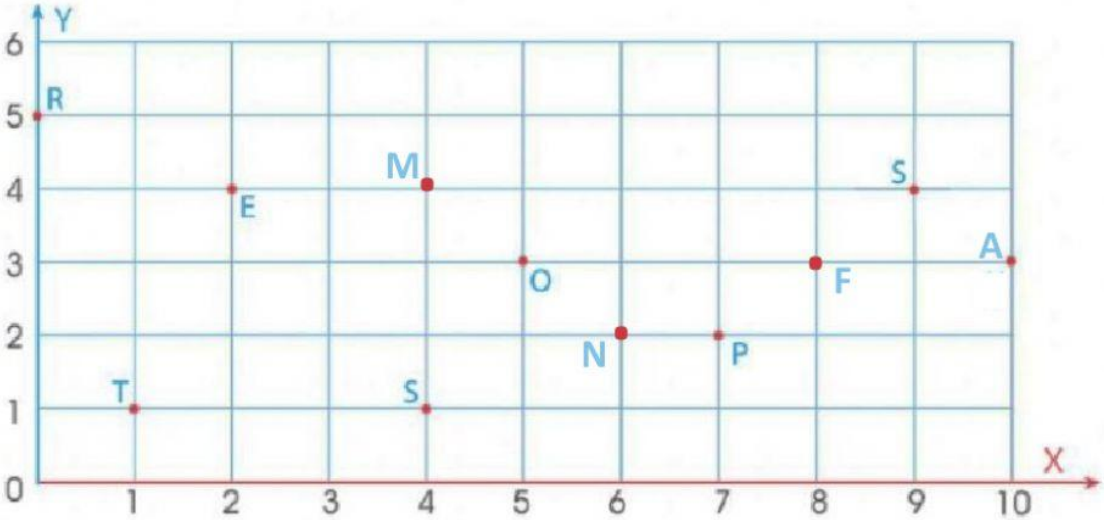

(7,2)	(0,5)	(5,3)	(8,3)

(4,1)	(10,3)	(0,5)	(4,4)	(2,4)	(6,2)	(1,1)	(5,3)

LIVEWORKSHEETS

3. Dê as coordenadas dos municípios destacados abaixo.

Macapá (,)

Mazagão (,)

L. do Jari (,)

4. Localize os pontos no plano

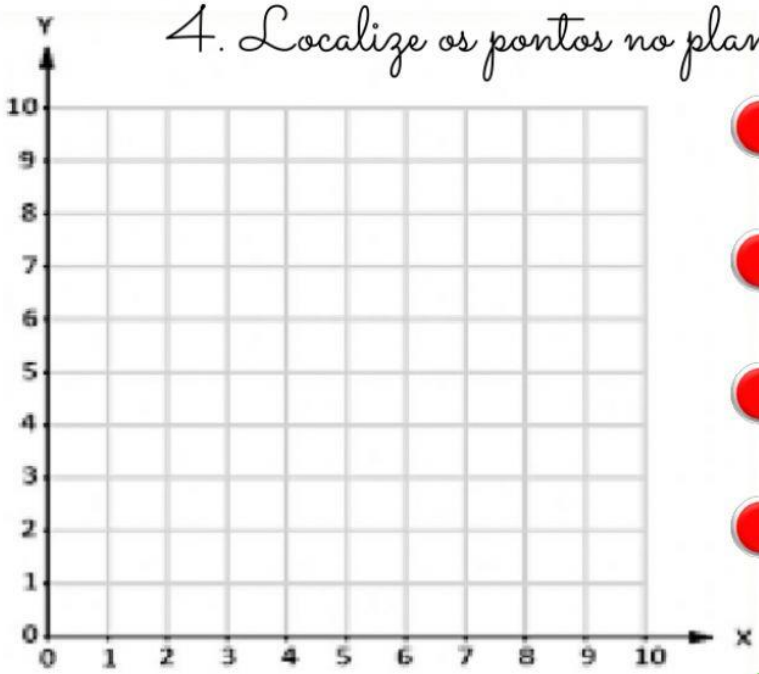

(1, 4)

(4, 1)

(8, 6)

(5, 5)

LIVEWORKSHEETS