Nombre: _____ Fecha:_____

✓ utilizar tus círculos de fracción para encontrar la fracción equivalente de cada figura.

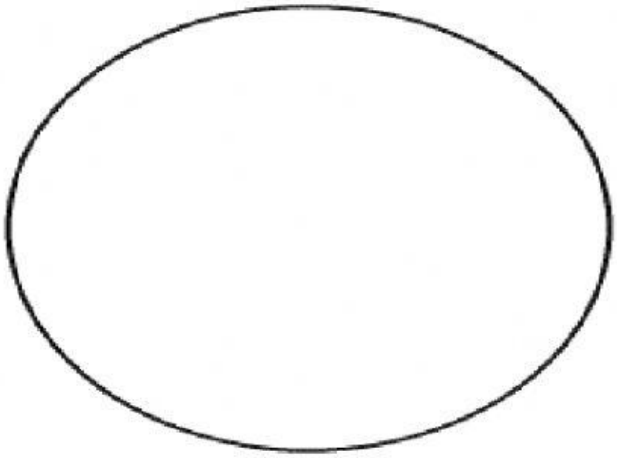

$$1 = \frac{\square}{\square} = \frac{\square}{\square} = \frac{\square}{\square}$$

$$= \frac{\square}{\square} = \frac{\square}{\square} = \frac{\square}{\square}$$

$$= \frac{\square}{\square} = \frac{\square}{\square}$$

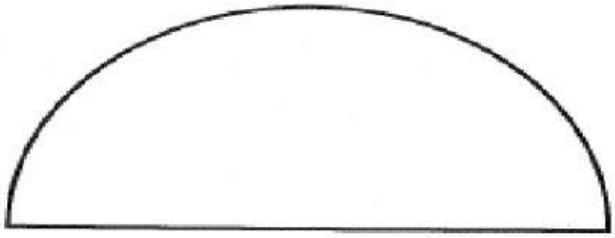

$$\frac{1}{2} = \frac{\square}{\square} = \frac{\square}{\square} = \frac{\square}{\square}$$

$$= \frac{\square}{\square} = \frac{\square}{\square}$$

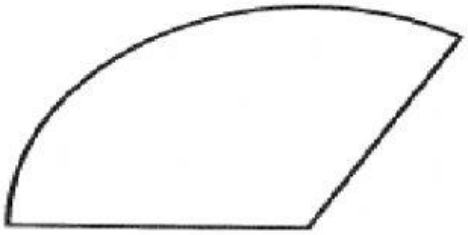

$$\frac{1}{3} = \frac{\square}{\square} = \frac{\square}{\square}$$

LIVEWORKSHEETS