Área de paralelogramos

Los paralelogramos son cuadriláteros que tienen dos pares de lados paralelos.

Son el rectángulo, cuadrado, romboide y rombo

Para calcular su área debes multiplicar la base y su altura.

Calcula el área de los siguientes paralelogramos.

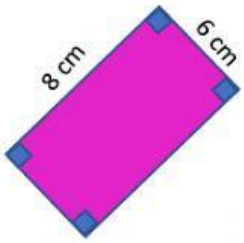

Área = cm²

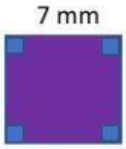

Área = mm²

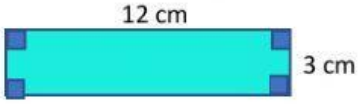

Área = cm²

Área = mm²

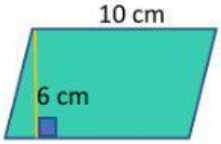

Área = cm²

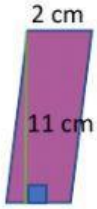

Área = cm²

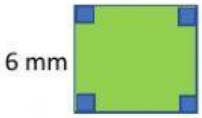

Área = mm²

Área = cm²

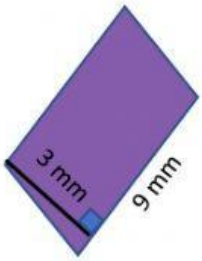

Área = mm²

LIVEWORKSHEETS