Division

Divide 4 glasses of milk between 2 kids. How many does each get?



Divide 6 glasses of milk between 3 kids. How many does each get?



Divide 3 glasses of milk between 1 kid. How many does he get?



Can you make your own division problem?

LIVEWORKSHEETS