Surface Area of a Cuboid (II) Ex.1

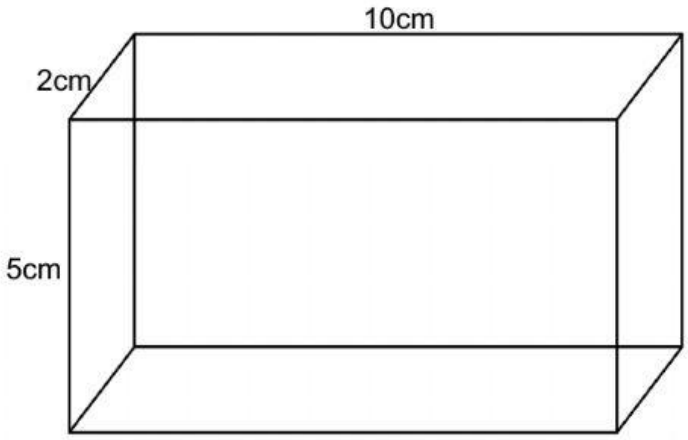

Area of 2 faces (front and back) = _____cm² x 2 = _____cm²

Area of 2 faces (top and bottom) = _____cm² x 2 = _____cm²

Area of 2 faces (left and right) = _____cm² x 2 = _____cm²

Total surface area =_____cm²

LIVEWORKSHEETS

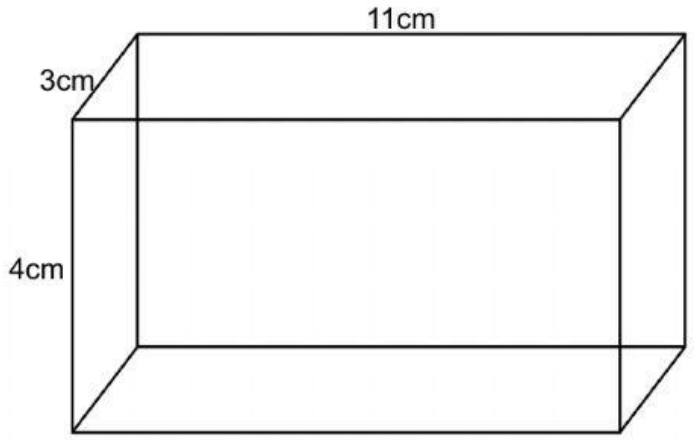

Area of 2 faces (front and back) = _____cm² x 2 = _____cm²

Area of 2 faces (top and bottom) = _____cm² x 2 = _____cm²

Area of 2 faces (left and right) = _____cm² x 2 = _____cm²

Total surface area =_____cm²

LIVEWORKSHEETS

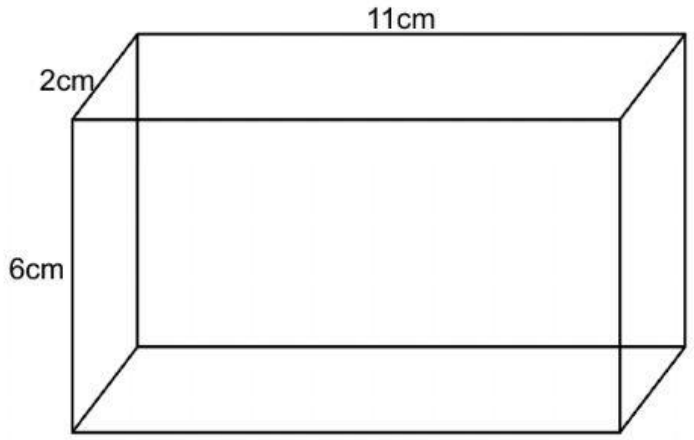

Area of 2 faces (front and back) = _____cm² x 2 = _____cm²

Area of 2 faces (top and bottom) = _____cm² x 2 = _____cm²

Area of 2 faces (left and right) = _____cm² x 2 = _____cm²

Total surface area =_____cm²

LIVEWORKSHEETS