GET READY FOR THE TEST – PART 1

Add 100 to each number

376		795	
286		57	
12		4 789	

Subtract 1000 to each number

5 307		9 362	
8 445		1 001	
20 832		14 056	

Which are the multiples of 9?

17	81	27
33	95	35
45	108	53

Which are the factors of 39?

1 2 3 4 5 8 9 10 13

14 15 20 25 39

Divide each number by 100

700		2 300	
6 480		7 080	
1 030		9 670	
300		900	
20		18 000	

Multiply by 100

6.25	
11.75	
35.56	

Round these decimals up or down to the nearest whole number

4.29		7.86	
6.57		59.45	
7.43		42.71	

LIVEWORKSHEETS

Make the fraction equal by putting a number in the box

$\frac{1}{8} = \frac{\square}{16} = \frac{3}{\square} = \frac{\square}{32} = \frac{\square}{40} = \frac{6}{\square}$

$\frac{20}{100} = \frac{\square}{25} = \frac{2}{\square} = \frac{1}{\square} = \frac{\square}{50} = \frac{\square}{200}$

Write each fraction as a decimal

$\frac{1}{4}$		$\frac{1}{2}$	
$\frac{2}{5}$		$\frac{3}{5}$	
$\frac{2}{10}$		$\frac{3}{10}$	
$\frac{6}{10}$		$\frac{7}{10}$	

Write each decimal as a fraction

0.3		0.4	
0.2		0.75	
0.5		0.8	
0.6		0.9	

Shade the amount shown in each shape

Two-fifths

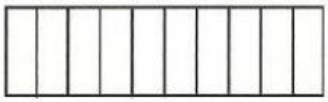

Four-fifths

Three-tenths

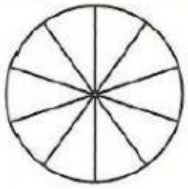

Seven-tenths



Three-fifths

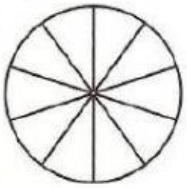

Nine-tenths



Find $\frac{1}{2}$ of these amounts

24 cm		16 l	
£1.50		36 hours	
14 hours		24 cm	

LIVEWORKSHEETS