Completa la serie de 10 en 10. Escribe después en los cuadros la serie que has creado.

Contamos de 10 en 10







20

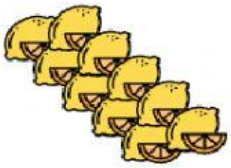

40



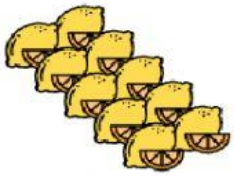

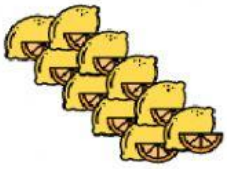





80



María José Ahumada Chamorro -2021

LIVEWORKSHEETS