فريق التحدي

المخروط و الأسطوانة

1 – صل الصورة بالمفردة المناسبة ؟



الاسطوانة

المخروط

2 –اختر الجسم الذي له الوجه الموضح  ؟





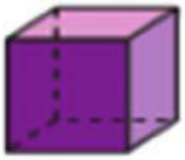

LIVEWORKSHEETS