RETEACH 8-1

LESSON 8-1 **Reteach**

Building Blocks of Geometry

You can think of real-life objects to represent geometric terms.

Point: a polka dot

Point *A*

Line: a straight road in both directions



Line *BC*, or $\overleftrightarrow{BC}$

Ray: flashlight beam

Ray *PQ*, or $\overrightarrow{PQ}$

Line segment: a ruler

Line segment *GH*, or $\overline{GH}$

Part of a plane: table top

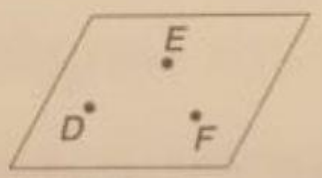

Plane *DEF*

Congruent line segments: lines on an index card



$\overline{WX} \cong \overline{YZ}$

For 1–5, use geometry notation to identify the figures.

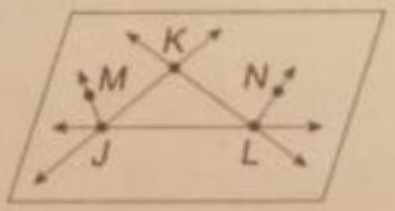

1. three points

2. three lines

3. a plane

4. three rays

5. three line segments

6. Identify the congruent line segments in the figure at the right.

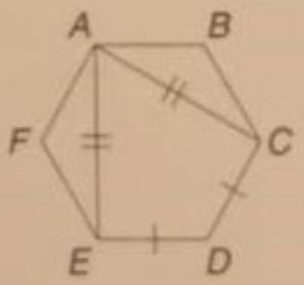

LIVEWORKSHEETS