Grade 1 Mathematics

Number pair to 10

Complete.



1 + 9

__ + __

__ + __

__ + __

__ + __

__ + __

__ + __

__ + __

__ + __

__ + __

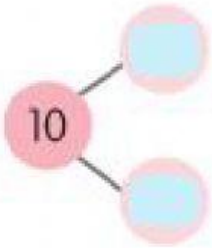

__ and __ make 10.

__ + __ = 10

LIVEWORKSHEETS

Let's Practise

1. What are the missing numbers?

(a)

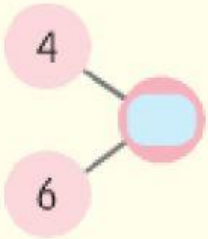

(b)

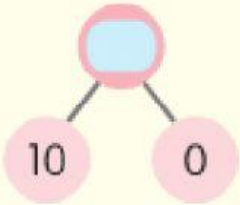

2. Complete the sentences.

(a) 7 and ____ make 10.
7 + ____ = 10

(b) ____ and 9 make 10.
____ + 9 = 10

Subtract from 10

Let's Practise

1. What are the missing numbers?

(a)

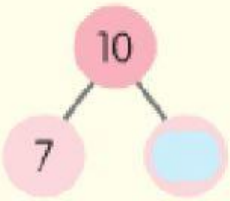

(b)

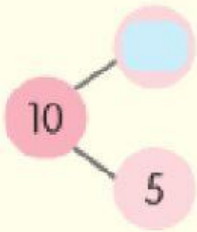

(c)

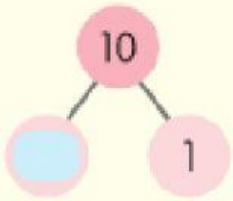

2. Complete.

(a) 10 − ____ = 2
(b) ____ + 2 = 10
(c) 10 − ____ = 4
(d) ____ + 4 = 10
(e) 10 − ____ = 3
(f) ____ + 3 = 10
(g) 10 − ____ = 10
(h) ____ + 0 = 10

LIVEWORKSHEETS