Name: _____

Direction: Count each set of blocks using place value. Drag and match the word form to the correct picture.

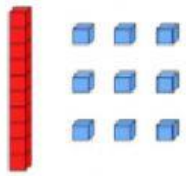	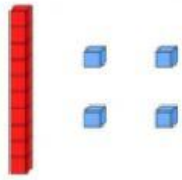	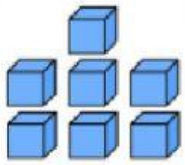
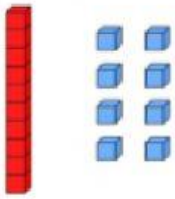	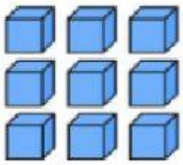	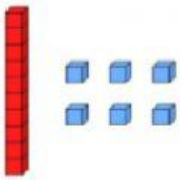
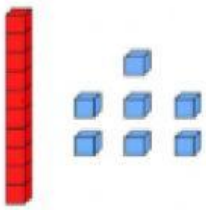		

2 tens	1 ten and 7 ones	7 ones
1 ten and 4 ones	8 ones	1 ten and 9 ones
9 ones	1 ten and 6 ones	1 ten and 8 ones

LIVEWORKSHEETS