RAB

CAMPO DE PENSAMIENTO MATEMÁTICO

3°

NOMBRE:

CURSO: FECHA:

1. Observa las imágenes y completa las operaciones.

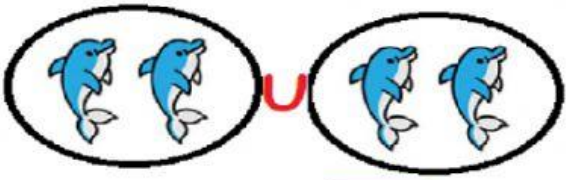

A. 2 veces 2 =

B. 2 + 2 =

C. 2 x 2 =



A. 2 veces 5 =

B. 5 + 5 =

C. 2 x 5 =



A. 3 veces 3 =

B. 3 +3+3 =

C. 3 x 3 =



A. 3 veces 4 =

B. 4 + 4 + 4 =

C. 4 x 3 =

LIVEWORKSHEETS