MATEMÁTICA

CLIQUE NO VASO QUE CONTÉM UMA FLOR



CLIQUE NO BOLO QUE CONTÉM APENAS UMA VELA

CLIQUE NO NINHO QUE CONTÉM 4 OVOS



LIVEWORKSHEETS



MARQUE QUANTAS PESSOAS HÁ FORA DO ÔNIBUS.

1	2	3	4

QUANTAS CRIANÇAS HÁ EM CADA FILA? ANOTE.



LIVEWORKSHEETS

ANOTE NA LOUSA O PRÓXIMO NÚMERO QUE O MENINO DEVE ESCREVER.

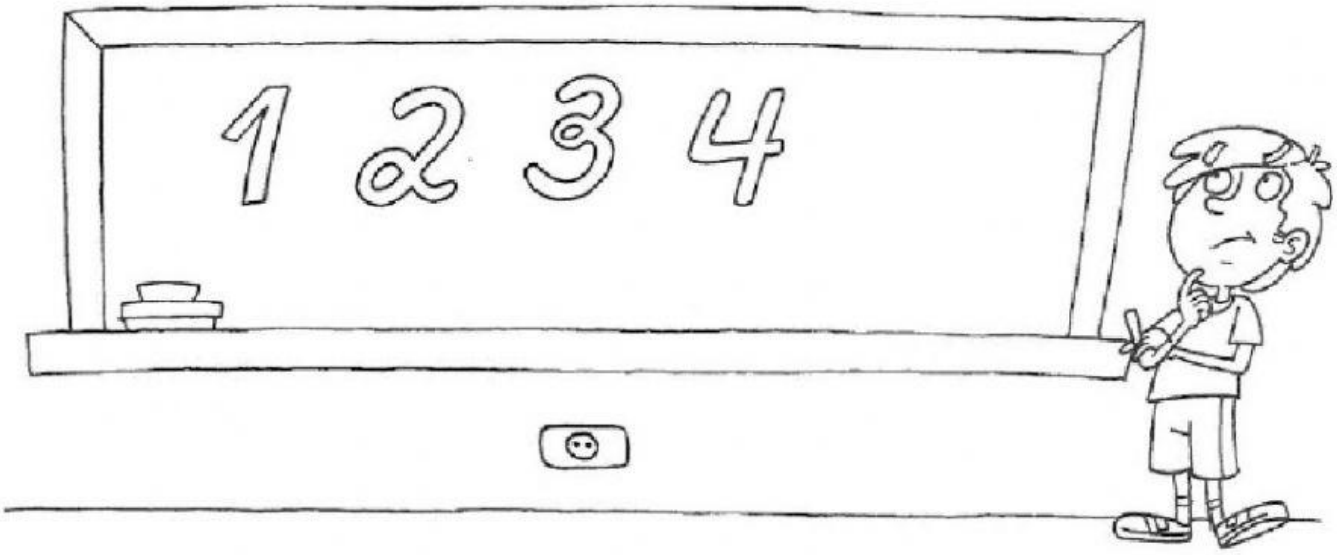

QUANTOS BALÕES CADA CRIANÇA TEM? ANOTE



LIVEWORKSHEETS

COMPLETE A SEQUÊNCIA NUMÉRICA.

1			4				

QUANTOS PEIXES FALTAM PARA QUE HAJA **8** EM CADA AQUÁRIO?

A

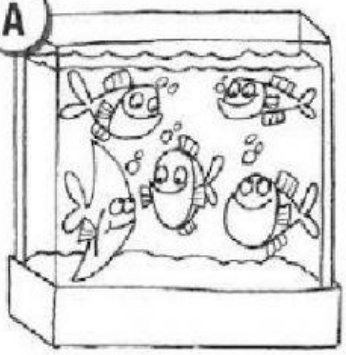

B

C

LIVEWORKSHEETS

CLIQUE NAS 8 CRIANÇAS QUE ESTÃO MAIS PRÓXIMAS À MESA DA PROFESSORA.

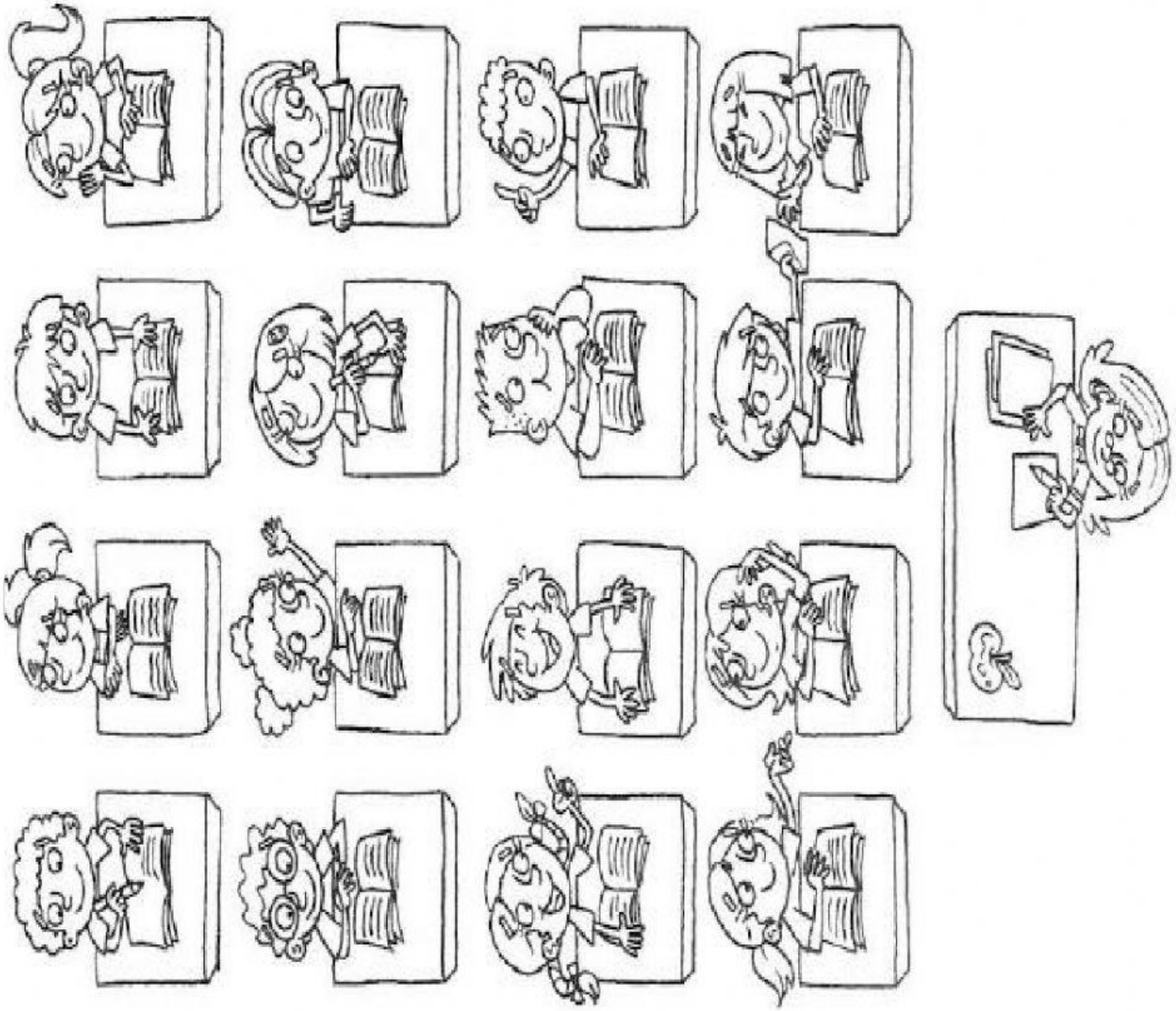

LIVEWORKSHEETS