Relación de pertenencia

Nombre: _____

1. Observa los subconjuntos que se han formado y establece la relación de pertenencia haciendo clic en el símbolo que corresponda.



 ∈ ∉ T

∈ ∉ A

∈ ∉ T

∈ ∉ T

∈ ∉ A

 ∈ ∉ A

∈ ∉ M

∈ ∉ M

LIVEWORKSHEETS