TOPIK 5.0 : NISBAH TRIGONOMETRI

5.1.4 Menentukan Nilai Sinus, Kosinus Dan Tangen Bagi Sudut Tirus

1. Lengkapkan jadual di bawah dengan nilai sin θ, kos θ dan tan θ.

a) 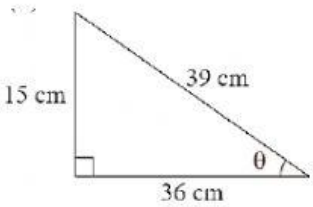 sin θ = $\frac{\square}{\square}$ kos θ = $\frac{\square}{\square}$ tan θ = $\frac{\square}{\square}$	b) 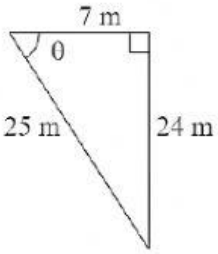 sin θ = $\frac{\square}{\square}$ kos θ = $\frac{\square}{\square}$ tan θ = $\frac{\square}{\square}$	c) 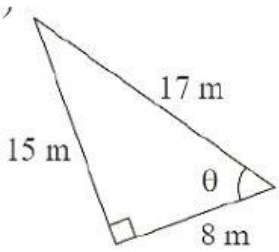 sin θ = $\frac{\square}{\square}$ kos θ = $\frac{\square}{\square}$ tan θ = $\frac{\square}{\square}$
d) 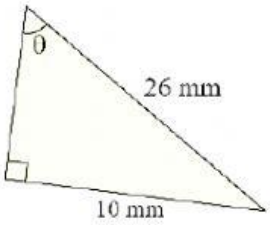 sin θ = $\frac{\square}{\square}$ kos θ = $\frac{\square}{\square}$ tan θ = $\frac{\square}{\square}$	e) 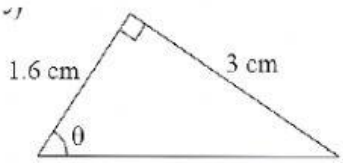 sin θ = $\frac{\square}{\square}$ kos θ = $\frac{\square}{\square}$ tan θ = $\frac{\square}{\square}$	f) 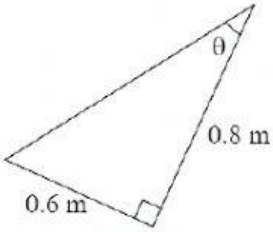 sin θ = $\frac{\square}{\square}$ kos θ = $\frac{\square}{\square}$ tan θ = $\frac{\square}{\square}$

LIVEWORKSHEETS