Los Altos

3RD TRIMESTRER SCIENCE EXAM
SCHOOL YEAR 20-21

1º

I. Classify the food as HEALTHY and UNHEALTHY.

Healthy			
Unhealthy			

II. Choose the activities that are GOOD for your health.

LIVEWORKSHEETS

III. Look at the picture. Choose ALL the correct sentences about the boy.

- The boy is CLEAN.
- The boy needs to TAKE A SHOWER.
- The boy needs to WASH his clothes.
- The boy is DIRTY.

IV. Look at the picture. Label the sides of the Earth as DAY or NIGHT.

V. Complete the sentences. Use the words from the boxes:

nighttime	stars	moon	24 hours	daytime

1. The sun SHINES during the _____.
2. At NIGHT we can see the _____ and the _____.
3. There are _____ in ONE day.
4. When the sun GOES DOWN it is _____.

LIVEWORKSHEETS

VI. **Match the pictures with the correct time of the day. Look at the position of the SUN and the MOON. DRAW a line.**



Morning

Afternoon

Evening

Night

VII. **Classify the animals as Diurnal and Nocturnal.**

Diurnal	Nocturnal

LIVEWORKSHEETS

1. Match the SEASON with its name. MOVE the words to the pictures.

Spring | Summer | Autumn | Winter



VIII. Look at the pictures. CHOOSE the things that ALL LIVING THINGS need.

LIVEWORKSHEETS

IX. **Match the part of the body with its corresponding sense.**

Hearing	
Taste	
Touch	
Smell	
Sight	



LIVEWORKSHEETS