# SCIENCE YEAR 4 (UNIT 3 : VERTEBRATES & INVERTEBRATES)

## INSTRUCTION : FILL IN THE BLANK WITH THE CORRECT ANSWER

**4.** The table below shows the classification of vertebrates animal. LS3.2.3

PL3 PL4 (a) Complete the table with the correct characteristics.

| Group of animals | Characteristics |
|---|---|
|  Group P | i. _____ blooded<br>ii. Breathe through their _____<br>iii. Breed by _____<br>iv. Body covered with _____ |
|  Group Q | i. _____ blooded<br>ii. Breathe through the _____<br>iii. Breed by _____<br>iv. Body covered with _____<br>and have _____ |
|  Group R | i. _____ blooded<br>ii. Breathe through the _____<br>iii. Breed by _____<br>iv. Body covered with _____ and _____ |
|  Group S | i. _____ blooded<br>ii. Breathe through their _____<br>iii. Breed by _____<br>iv. Body covered with _____ |
| 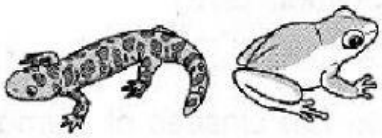 Group T | i. _____ blooded<br>ii. Breathe through their _____<br>and _____<br>iii. Breed by _____<br>iv. Live in _____ and on _____ |



LIVEWORKSHEETS

# SCIENCE YEAR 4 (UNIT 3 : VERTEBRATES & INVERTEBRATES)



Group P



Group Q



Group S



Group R

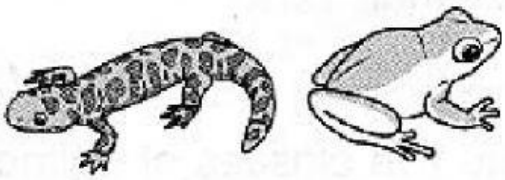

Group T

(b) Name the following groups.

Group P: _____ Group S: _____

Group Q: _____ Group T: _____

Group R: _____



LIVEWORKSHEETS