Complete the given table.

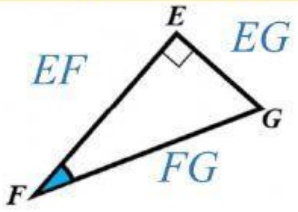

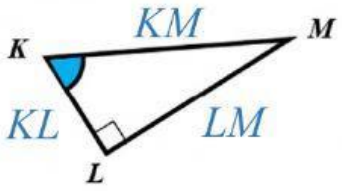

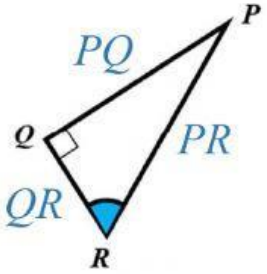

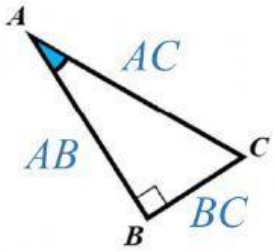

Triangles	Hypotenuse	Opposite side	Adjacent side
ΔEFG			
ΔKLM			
ΔPQR			
ΔABC			

LIVEWORKSHEETS