SISI PERSEGI

Nama: _____ **Kelas:** _____

Tentukan sisi dari setiap persegi berikut!



Keliling: 20 cm

Sisi: _____

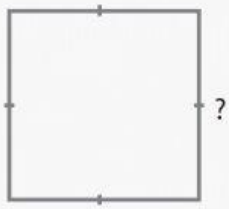

Keliling: 32 cm

Sisi: _____

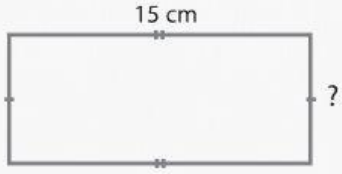

Keliling: 40 cm

Sisi: _____

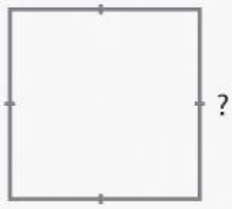

Keliling: 28 cm

Sisi: _____



Keliling: 48 cm

Sisi: _____

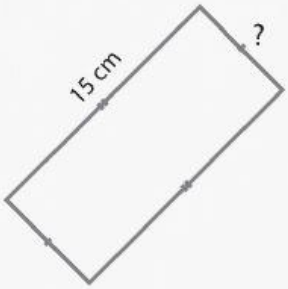

Keliling: 42 cm

Sisi: _____

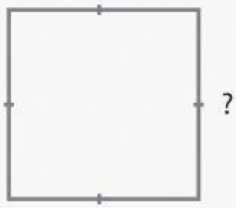

Keliling: 30 cm

Sisi: _____



Keliling: 20 cm

Sisi: _____

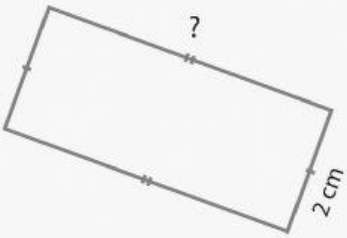

Keliling: 16 cm

Sisi: _____

LIVEWORKSHEETS