VOLUME: COUNT THE CUBES 1

Write down the volume of each of these shapes by working out the number of cubes.

1) 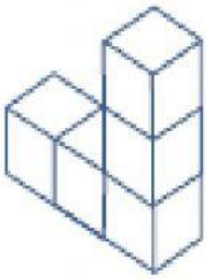	2)	3) 
Volume: _____ cubes	Volume: _____ cubes	Volume: _____ cubes

4) 	5)	6) 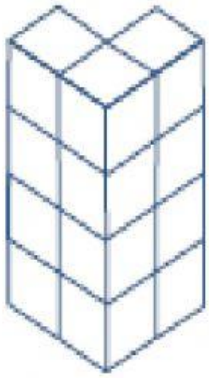
Volume: _____ cubes	Volume: _____ cubes	Volume: _____ cubes

7) 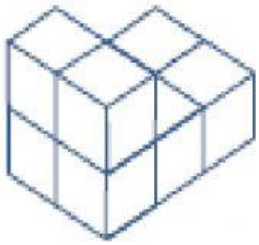	8)	9) 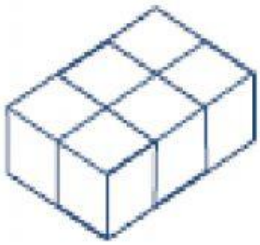
Volume: _____ cubes	Volume: _____ cubes	Volume: _____ cubes

LIVEWORKSHEETS