What IS the Angle?

Identify each of these angles by matching each one to the correct type.

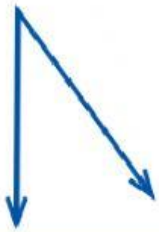

Less than right angle
Right angle
Greater than right angle



Less than right angle
Right angle
Greater than right angle

Less than right angle
Right angle
Greater than right angle

Less than right angle
Right angle
Greater than right angle

Less than right angle
Right angle
Greater than right angle

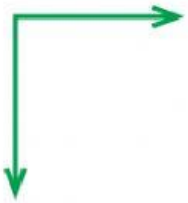

Less than right angle
Right angle
Greater than right angle



Less than right angle
Right angle
Greater than right angle

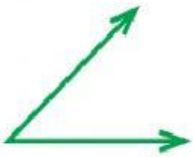

Less than right angle
Right angle
Greater than right angle

Less than right angle
Right angle
Greater than right angle

LIVEWORKSHEETS