1º Curso

Seguimos repasando

Busca todas las descomposiciones.



LIVEWORKSHEETS

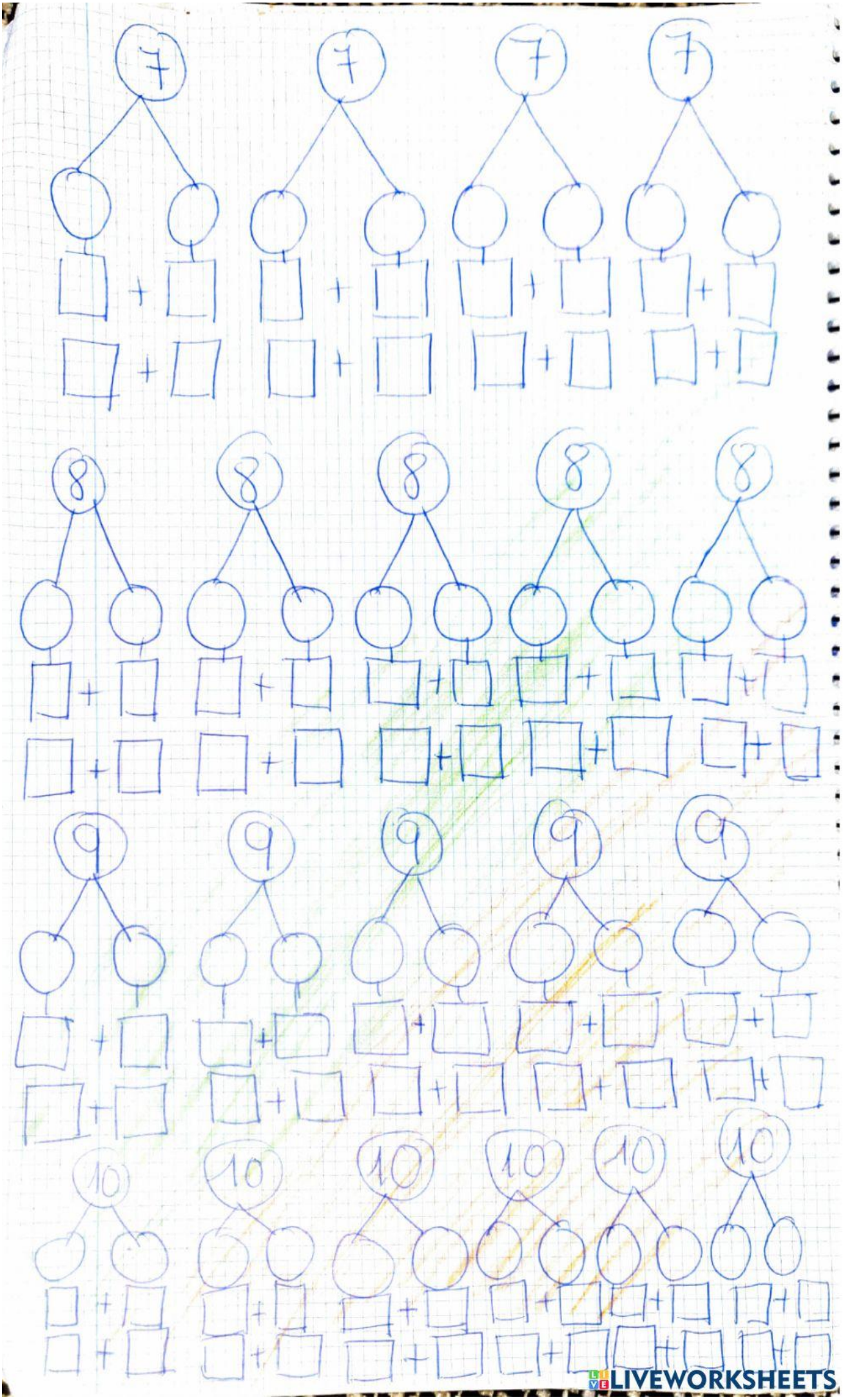

LIVEWORKSHEETS

Buscamos el 10 y sumamos

8 + 3

2 1

8 + 2 = 10

10 + 1 = 11

Resuelve ahora

- 9 + 7

  ☐ + ☐ = ☐

  ☐ + ☐ = ☐

- 8 + 6

  ☐ + ☐ = ☐

  ☐ + ☐ = ☐

- 9 + 8

  ☐ + ☐ = ☐

  ☐ + ☐ = ☐

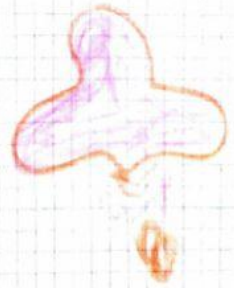

LIVEWORKSHEETS

Ahora restamos

$\boxed{10} - 6 = 4$

$\boxed{4} + \boxed{4} = 8$

¿Te has fijado bien?

$19 - 5 = \square$

$\square + \square$

$\square - \square$

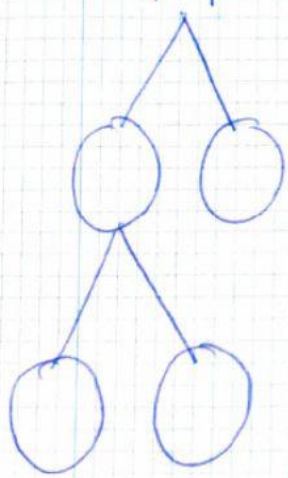

$18 - 4 = \square$

$\square - \square$

$\square + \square$



Ahora vamos a restar poco a poco

$19 - 7$

$\boxed{7} \xrightarrow{+3} \boxed{10} \xrightarrow{+9} \boxed{19}$

$19 - 7 = 3 + 9 = 10 + 2 = 12$

2 1

LIVEWORKSHEETS

Ahora tú solo

- 25 − 17 25−17 = □ + □

17 → (+) → □ → (+) → |

33 − 18 33−18 = □ + □

- 18 + (+) → □ → ( ) → □ =

- Ahora vamos a por los problemas

Edey tiene una colección de 65 fósiles y su amigo Yael tiene 28 fósiles menos que Edey. ¿Cuántos fósiles tiene Yael? ¿Cuántos fósiles tienen entre los dos?

- 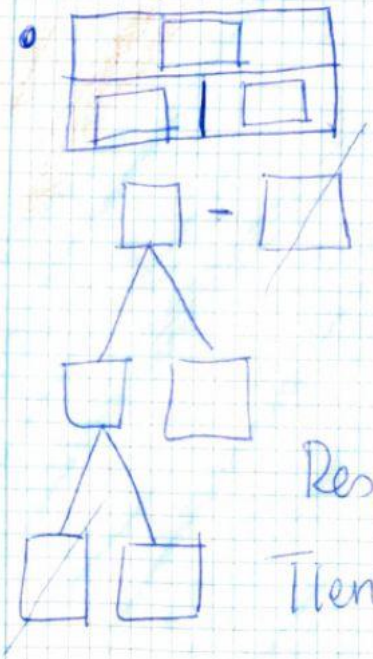

Respuesta:

Tiene □ fósiles

- 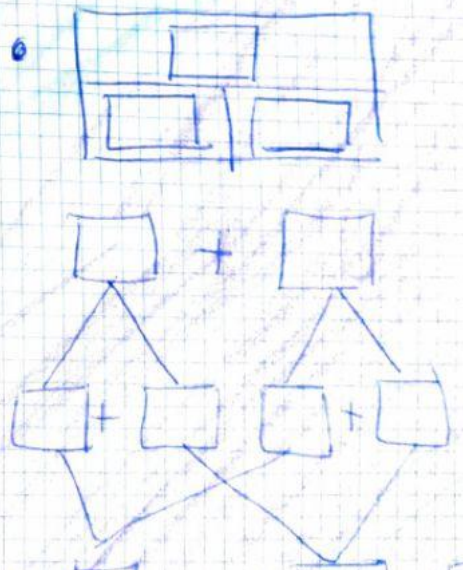

□ + □ = □

R: Tienen □ en total

LIVEWORKSHEETS