VERIFICA finale FORMULE
perimetri e aree. Classe 5°

Scrivi il nome della figura	Scegli la formula corretta del perimetro	Scegli la formula corretta dell'area
		
		

LIVEWORKSHEETS

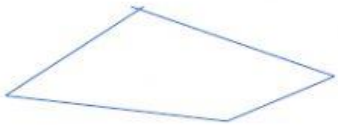		

LIVEWORKSHEETS

By unmondodiamici.blogspot.it

LIVEWORKSHEETS