5. 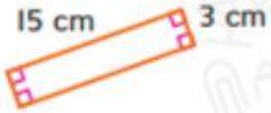

$P =$ _____

6. 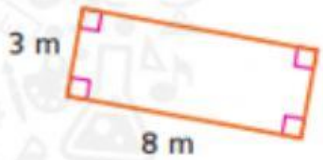

$P =$ _____

Algebra **Find the unknown side length. Write an equation to find the perimeter.**

7. 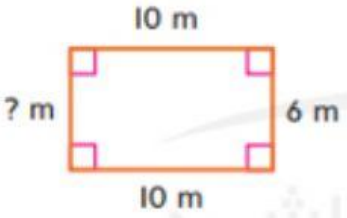

The unknown side length is ____m____.

_____

8. 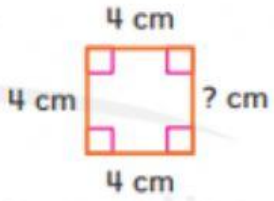

The unknown side length is ____m____.

_____

Find the perimeter of each rectangle in units.

9.

$P =$ ____units____

10.

$P =$ ____units____

LIVEWORKSHEETS