PDPR 17 MEI 2021
PECAHAN (Menyatakan pecahan perseratus)

1. Nyatakan nilai pecahan perseratus dan perpuluhan bagi petak berwarna.

Contoh:

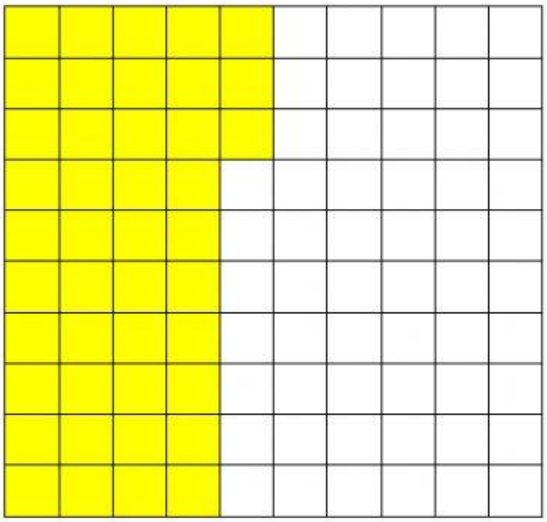

Pecahan perseratus:

$43/100$

Perpuluhan:

0.43

a)

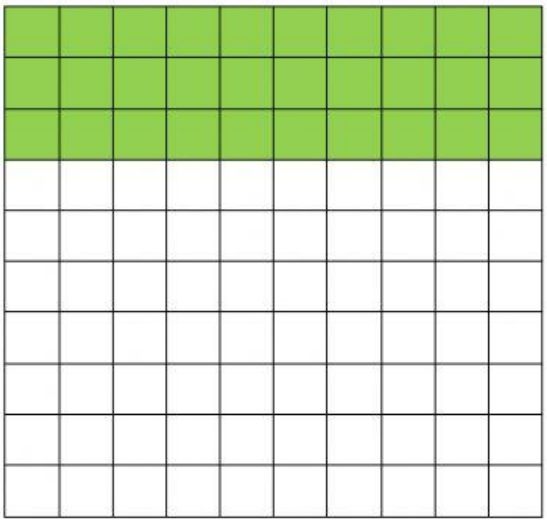

Pecahan perseratus:

Perpuluhan:

LIVEWORKSHEETS

b)

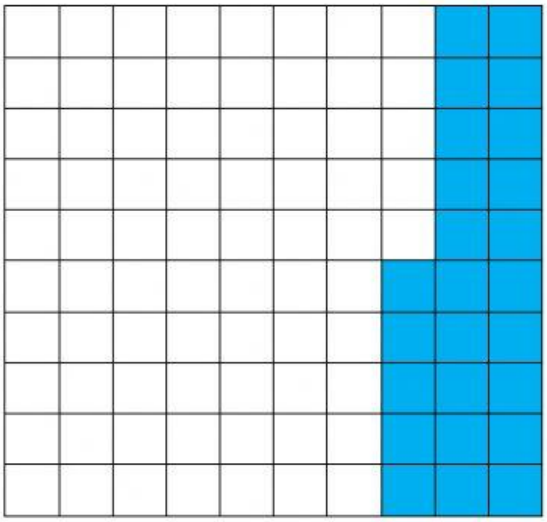

Pecahan perseratus:

Perpuluhan:

c)

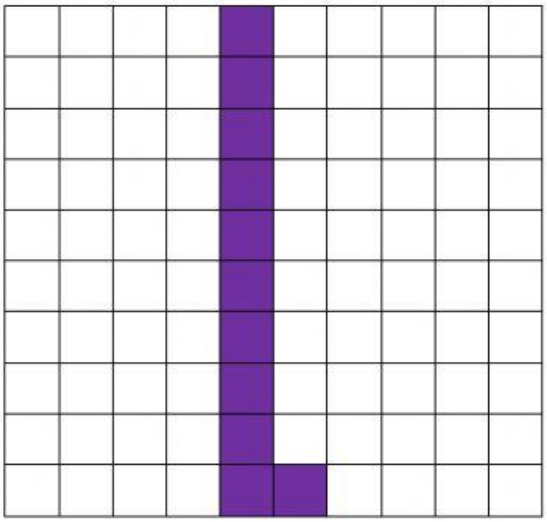

Pecahan perseratus:

Perpuluhan:

LIVEWORKSHEETS

2. Tulis perpuluhan dalam angka dan perkataan.

Contoh:

$\frac{17}{100}$ = 0.17 = sifar perpuluhan satu tujuh

a) $\frac{2}{100}$ = ☐ = ☐

b) $\frac{34}{100}$ = ☐ = ☐

c) $\frac{50}{100}$ = ☐ = ☐

LIVEWORKSHEETS