Assessment

Lesson title: faces, vertices, and edges

Question one: define the following terms: -

1. Faces:
2. Vertices:
3. and edges:

Question two: Define the names of these 3D shapes, then mention the number of vertices, edges, and faces of these shapes



Name of the shape:

Number of the vertices:

Number of the edges:

Number of the faces:

Name of the shape:

Number of the vertices:

Number of the edges:

Number of the faces:

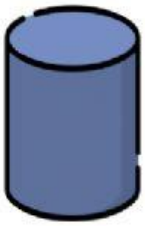

Name of the shape:

Number of the vertices:

Number of the edges:

Number of the faces:

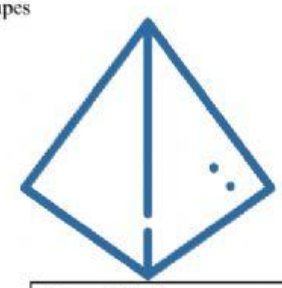

Name of the shape:

Number of the vertices:

Number of the edges:

Number of the faces:

LIVEWORKSHEETS