LIFE INTERNATIONAL SCHOOL

QUARTER 4 EXAM IN MATH

Grade 1B

Name: _____ Date: _____ Score: ____/ 45

FRACTIONS

What is the fraction of the shaded part?

$\frac{1}{5}$	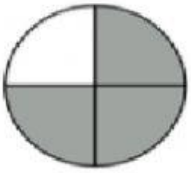 $\frac{_}{_}$
$\frac{_}{_}$	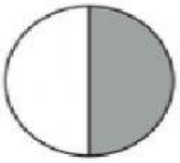 $\frac{_}{_}$
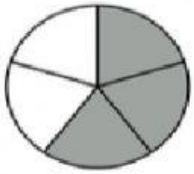 $\frac{_}{_}$	$\frac{_}{_}$
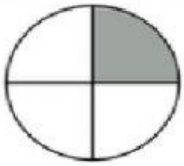 $\frac{_}{_}$	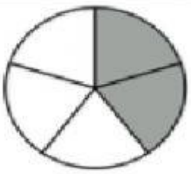 $\frac{_}{_}$
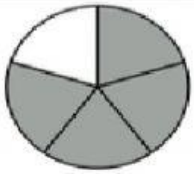 $\frac{_}{_}$	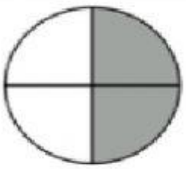 $\frac{_}{_}$

LIVEWORKSHEETS

Addition with Carrying

34	45	82	38
+ 38	+ 26	+ 18	+ 42

Subtraction with Borrowing

98	96	98	53
- 79	- 77	- 69	- 49

What time is it?

INSTRUCTIONS: Write the time below each clock.

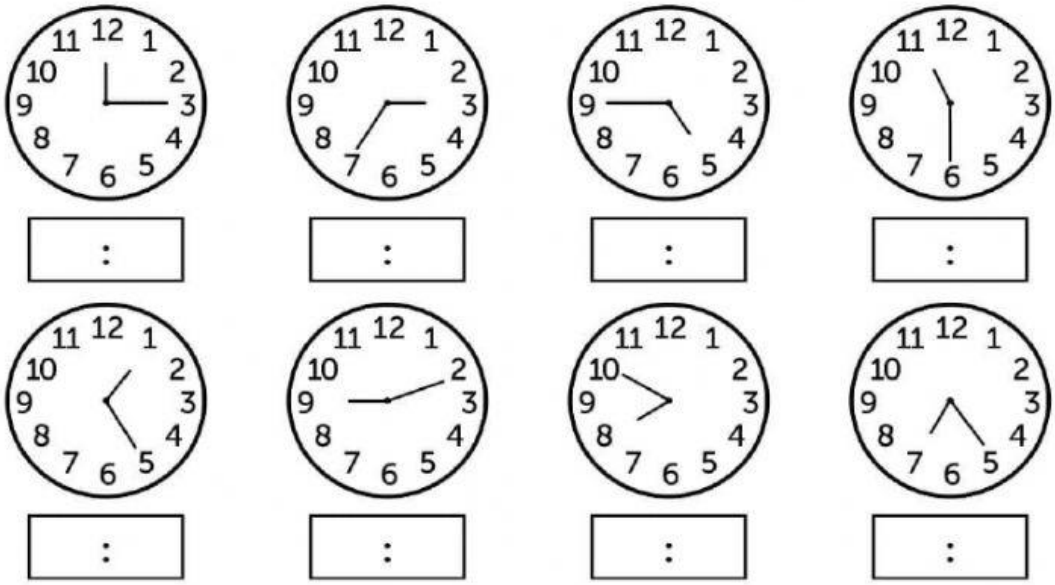

LIVEWORKSHEETS

Multiplication by 5

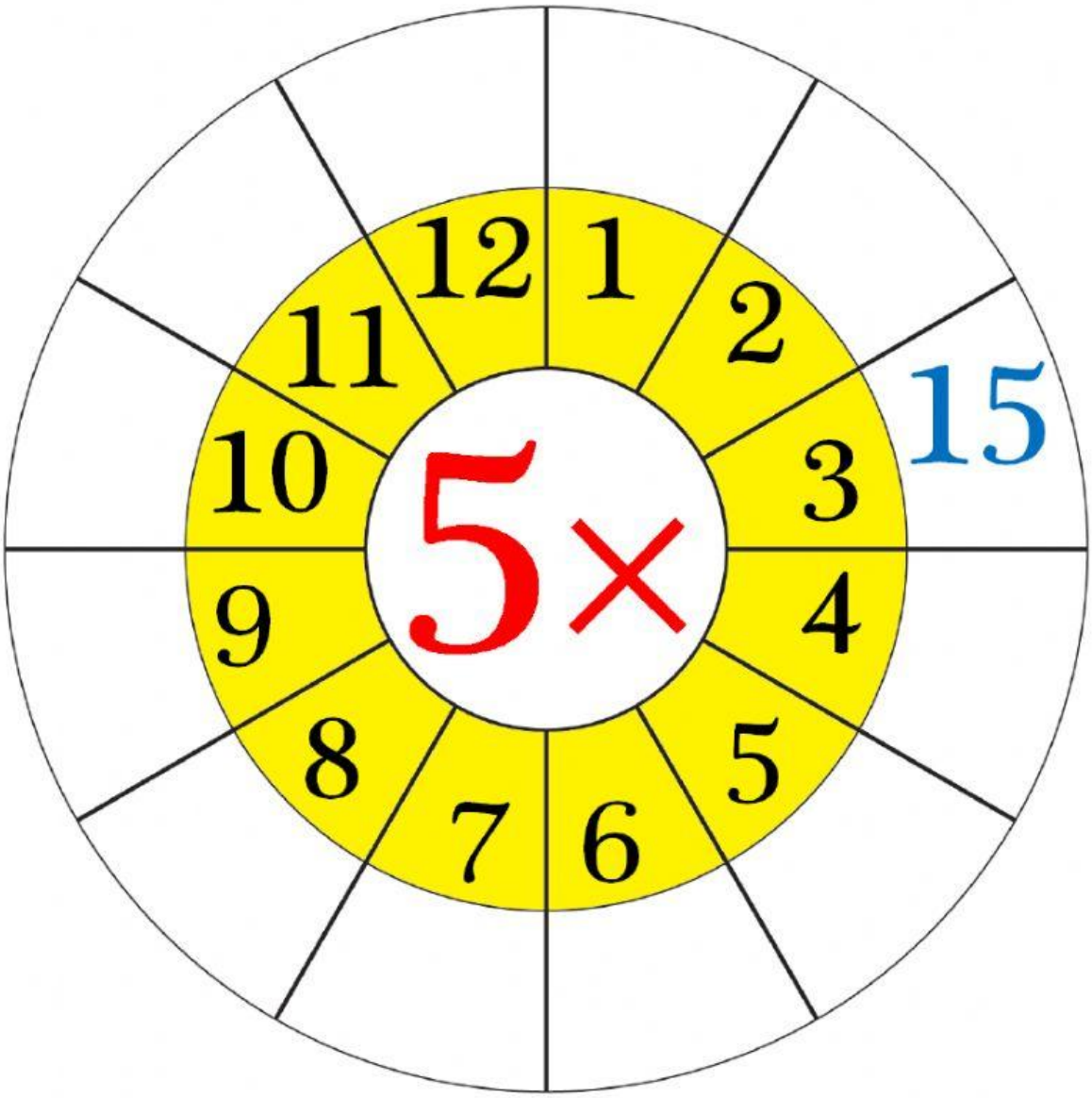

God Bless You!

LIVEWORKSHEETS