multiplicación

Una multiplicación se puede representar gráficamente mediante un arreglo rectangular.
Por ejemplo:

2x3= 6



3x4= 12

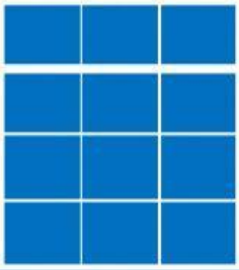

5x4= 20



- Relaciona cada multiplicación con el arreglo que la representa y resuélvela:



2 x 2 = _____



5 x 3 = _____



6 x 2 = _____

4 x 4 = _____

LIVEWORKSHEETS