JARGALAN INTERNATIONAL SCHOOL
PROGRESSION TEST 2nd grade

Name:……..

Section A term 3

1. Write the numbers to the right places. /3p/

1 It's windy.
2 It's sunny.
3 It's hot.
4 It's cloudy.
5 It's snowy.
6 It's cold.
7 It's rainy.

2. Match the minibeasts to their correct habitat. /3p/



LIVEWORKSHEETS

3. Look at the words ? Which one is a natural light source ? /1P/

A. Torch B. Sun C. Candle

4. Look at the picture and select the correct opinion. /2p/

3.

a. Rough

b. Smooth

4.

a. Trasnparent

b. Trasnlucent

5.

a. Soft

b. Hard

6.

a. Smooth

b. Soft

5. Tick the correct answer. /2p/

metal

wood

plastic

wood

glass

wood

LIVEWORKSHEETS

6. Circle the shadow of boy. /1p/



7. Which of these is a correct shadow ? Circle the correct answer. /1p/

a.

b.

c.

8. Look, read and complete. / morning, rotation, night, earth / /2p/

c. The _____ goes around the sun.

d. The earth's _____ causes day and night.

e. I sleep at _____ and wake up in the _____.

9. What can you see ? Tick the correct picture. /1p/

DAY

NIGHT



LIVEWORKSHEETS

10. Label the components of a simple circuit. /battery, wire, bulb / /2p/

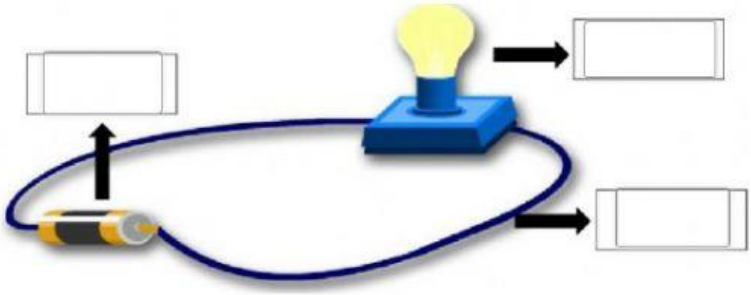

11. Label the part of the earth which is in daytime and which is in nighttime. /1p/

12. Match the animals to the right places. /3p/



LIVEWORKSHEETS

13. Look at the picture and select the correct opinion. /2p/

1.

a. Flexible

b. Rigid

2.

a. Soft

b. Hard

3.

a. Rough

b. Smooth

4.

a. Trasnparent

b. Trasnlucent

14. Look, read and complete. / moon, day, stars, sun, earth / /2p/

a. The _____ shines during the _____.

b. At night, we can see _____ and _____.

c. The _____ goes around the sun.

15. Look at the pictures match the objects into the correct box. /2p/

CHANGES WITH LIGHT		CHANGES WITH HEAT	

Ice cream

Bike Wheel

News paper

Plastic straws

LIVEWORKSHEETS