124.orria

4.-Bete itzazu "inkesta" honetan aterako liratekeen erantzunak.

		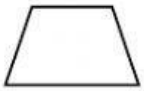				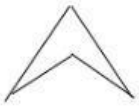
Paralelogramoa zara?						
Nola du izena?						
Zenbat simetria ardatz ditu?						
Diagonalak luzera berekoak al dira?						
Diagonalak, elkarrekin perpendikularrak al dira?						
Poligono erregularra al da?						
Diagonalak, angeluen erdibitzaileak al dira?						

LIVEWORKSHEETS

5.-Gogoratu triangeluaren aldeen erdiko puntuak lotzen dituzten zuzenkien ezaugarriak. Osatu.

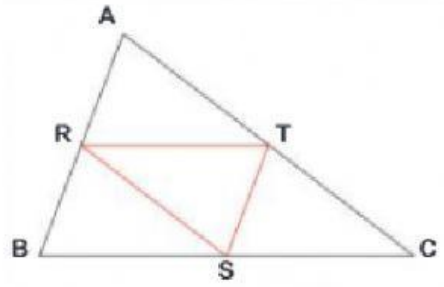

BC // RT RS TS

AB // RT RS TS

AC // RT RS TS

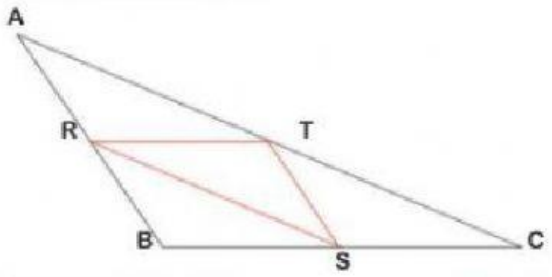

RS = ½ AB AC BC

RT = ½ AB AC BC

ST=1/2 AB AC BC

LIVEWORKSHEETS

6- Badakizu beren **aldeen luzeraren arabera** eta beren **angeluen zabaltasunaren arabera** sailkatzen direla triangeluak. Osatu bi taula hauek.

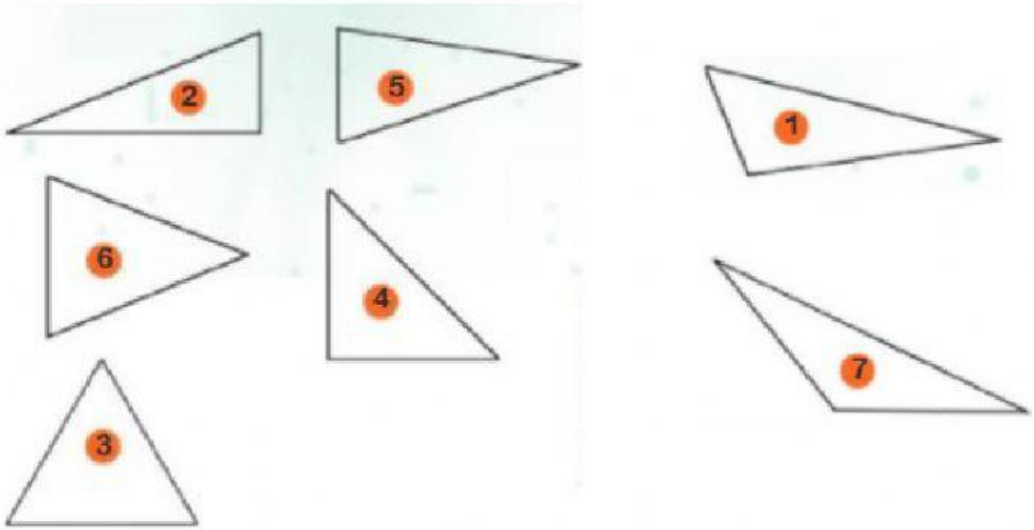

	Aldeberdina	Isoszelea	Eskalenoa
Angelukamutsa	X		
Angelu zuzena	X		
Angelu zorrotza			

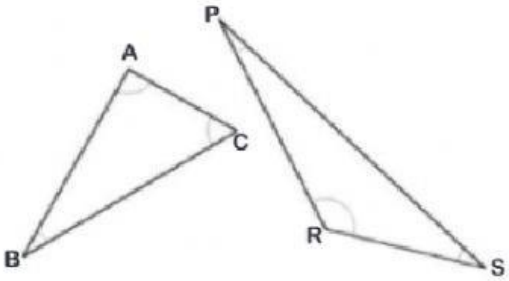

	ABC triangelua			PRS triangelua		
Angelua	A	B	C	P	R	S
Graduak						
Angeluen batura						

LIVEWORKSHEETS