Dubai Carmel School
مدرسة دبي كرمل

Maths Y 5 Equivalent Fractions - 2

Name :

Q1-Put the correct fraction into the box and fill in the answers below.

1)

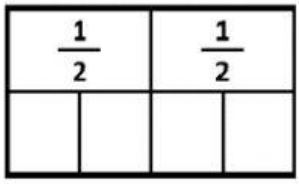

$\frac{1}{2} = \frac{\quad}{4}$

2)

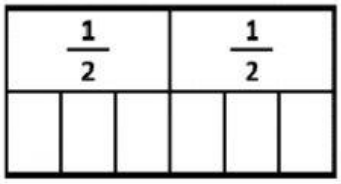

$\frac{1}{2} = \frac{\quad}{6}$

3)

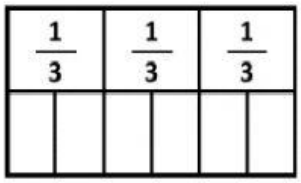

$\frac{1}{3} = \frac{\quad}{6}$

4)

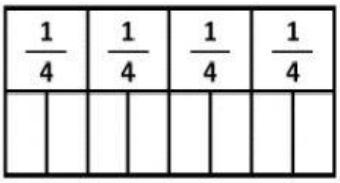

$\frac{1}{4} = \frac{\quad}{8}$

5)

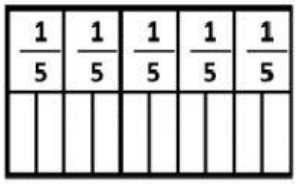

$\frac{1}{5} = \frac{\quad}{10}$

6)

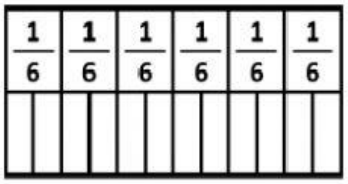

$\frac{1}{6} = \frac{\quad}{12}$

Now use the fraction walls to answer these questions.

7) $\frac{2}{2} = \frac{\quad}{4}$ 8) $\frac{3}{4} = \frac{\quad}{8}$ 9) $\frac{2}{3} = \frac{\quad}{6}$ 10) $\frac{2}{5} = \frac{\quad}{10}$

11) $\frac{3}{3} = \frac{\quad}{6}$ 12) $\frac{4}{6} = \frac{\quad}{12}$ 13) $\frac{4}{5} = \frac{\quad}{10}$ 14) $\frac{5}{6} = \frac{\quad}{12}$

LIVEWORKSHEETS