Escribe la fracción correspondiente a la parte coloreada

a) 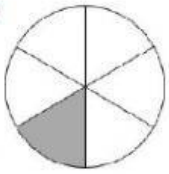

b) 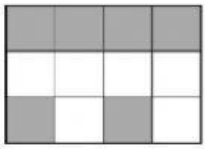

c) 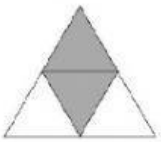

d) 

_____ _____ _____ _____

Escribe en forma de fracción.

- Tres cuartos de hora _____
- Dos quintas partes del camino _____
- Doce de cada veinticinco alumnos _____
- Media taza de café _____

¿Cuánto valen las siguientes fracciones?

$\frac{18}{3} =$ $\frac{20}{5} =$ $\frac{8}{2} =$ $\frac{14}{7} =$

Comprueba si son fracciones equivalentes.

$\frac{2}{4} = \frac{6}{12}$ _____ x _____ =

$\frac{6}{9} = \frac{2}{3}$ _____ x _____ =

LIVEWORKSHEETS