¿Cuánto falta de 8 hasta 14 ?

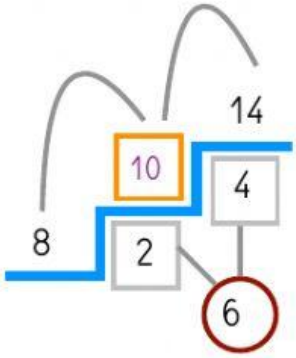

¿Cuánto falta de 9 hasta 17 ?

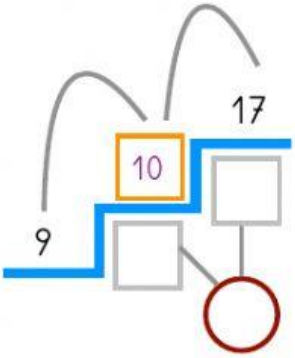

¿Cuánto falta de 6 hasta 13 ?

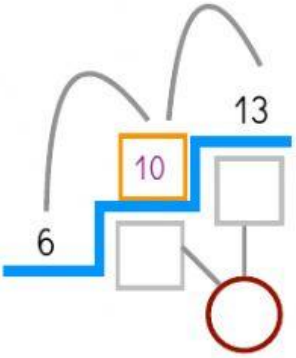

¿Cuánto falta de 7 hasta 15 ?

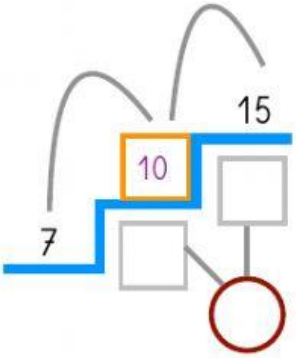

¿Cuánto falta de 5 hasta 14 ?

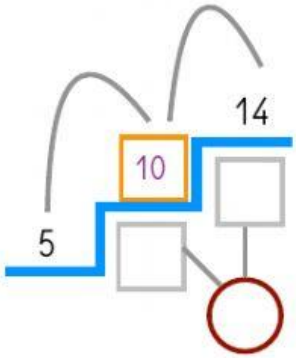

¿Cuánto falta de 4 hasta 12 ?

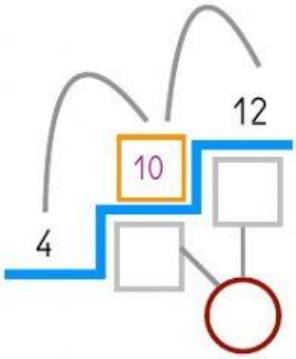

¿Cuánto falta de 8 hasta 14 ?

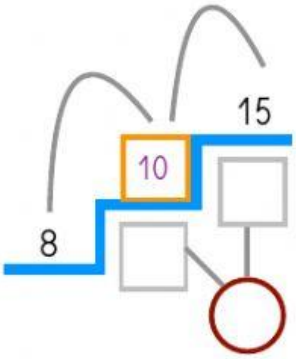

¿Cuánto falta de 6 hasta 14 ?

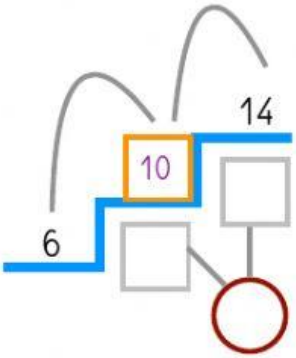

¿Cuánto falta de 3 hasta 11 ?

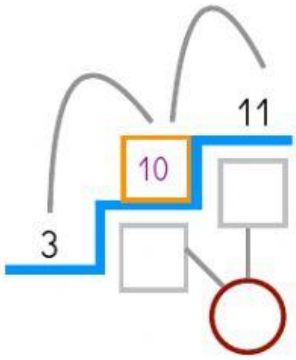

¿Cuánto falta de 2 hasta 11 ?

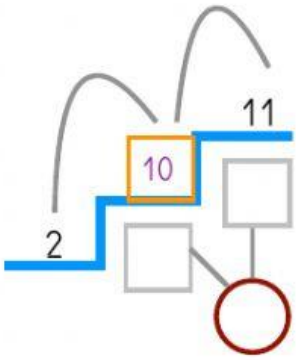

¿Cuánto falta de 6 hasta 15 ?

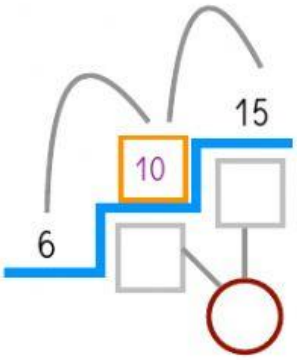

¿Cuánto falta de 7 hasta 14 ?

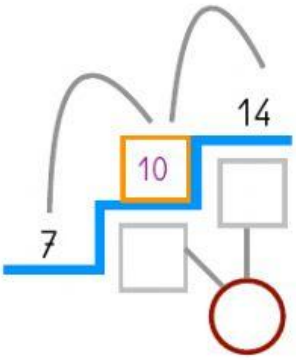

¿Cuánto falta de 5 hasta 13 ?

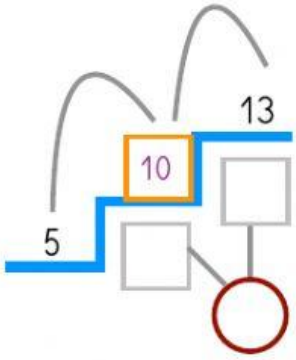

¿Cuánto falta de 4 hasta 11 ?

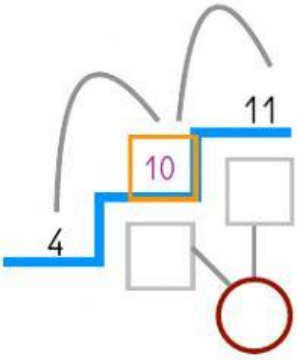

¿Cuánto falta de 9 hasta 16 ?

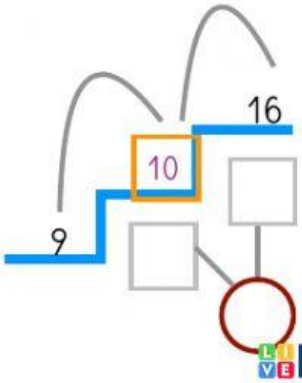

¿Cuánto falta de 6 hasta 11 ?

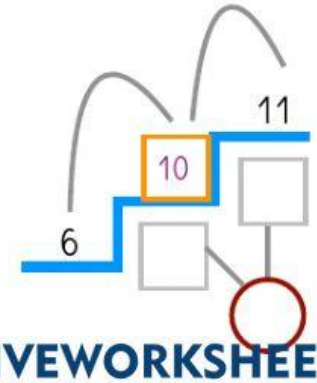

LIVEWORKSHEETS