KENDRIYA VIDYALAYA INS VALSURA

LIVEWORKSHEET, CLASS: IV A & B

CHAPTER: 1 BUILDING WITH BRICKS

❖ *Choose the correct answer from the following options:-*

Q.1) Which of the following is a drawing of a brick?

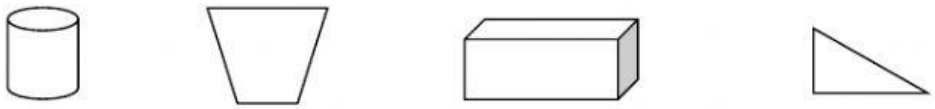

Q.2) How many faces does a brick have?

a) 4 b) 6 c) 8 d) 12

Q.3) The Cost of 1000 bricks is rupees 1200. The cost of 5000 bricks is ____.

a) 6000 b) 4000 c) 5000 d) 8000

Q.4) How many edges does a brick have?

a) 8 b) 12 c) 6 d) 4

Q.5) The cost of a brick is rupees 20/- then find the cost of 30 bricks?

a) 60 b) 50 c) 600 d) 4000

Q.6) Which the following is used to make a brick?

a) *Wood* b) *Plastic* c) *Iron* d) *Soil*

Q.7) What type of design you can see in the picture?

a) *Jaali* b) *Jharokha* c) *Arch* d) *Simple wall*

Q.8) Where is the Jagriti School located?

a) *Murshidabad* b) *Malda* c) *Kalimpong* d) *Kolkata*

Q.9)Which design of the wall is expected to be the weakest?





Q.10) What type of design you can see in the picture?

a) *Jaali* b) *Jharokha* c) *Arch* d) *Simple wall*

LIVEWORKSHEETS

LIVEWORKSHEETS