EXAMEN BIMESTRAL DE GEOMETRÍA

INSTITUCIÓN EDUCATIVA PRIVADA
"SEMILLITAS DE VIDA"

PROFESORA: AILY MELISSA GUTARRA BONIFAZ

1. OBSERVA LA FIGURA Y COLOCA VERDADERO (V) O FALSO (F)

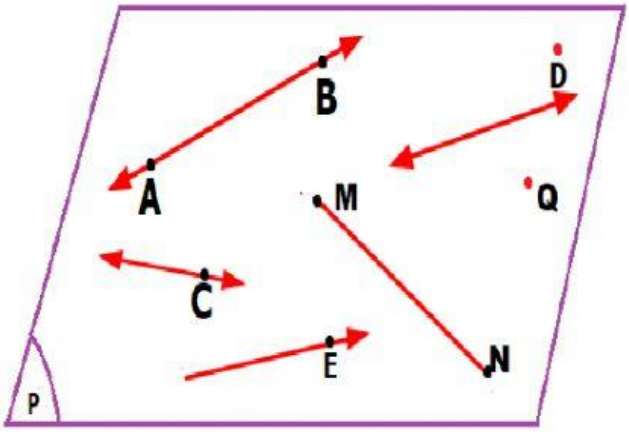

- El punto **Q** pertenece al plano **P.** ☐
- El segmento **MN** pertenece al plano **P.** ☐
- El rayo **AB** pertenece al plano **P.** ☐
- La semi recta **D** pertenece al plano **P.** ☐
- La semi recta **E** pertenece al plano **P.** ☐

2. NOMBRA CADA UNA DE LAS SIGUIENTES FIGURAS (LETRA MAYÚSCULA)

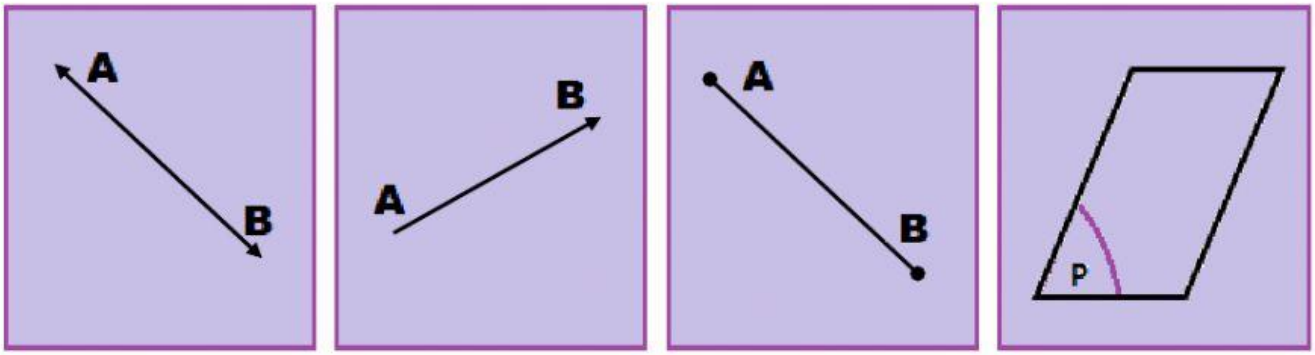

3. ¿CUÁL DE LAS SIGUIENTES GRAFICAS REPRESENTA A UN RAYO? Pulsa tu respuesta

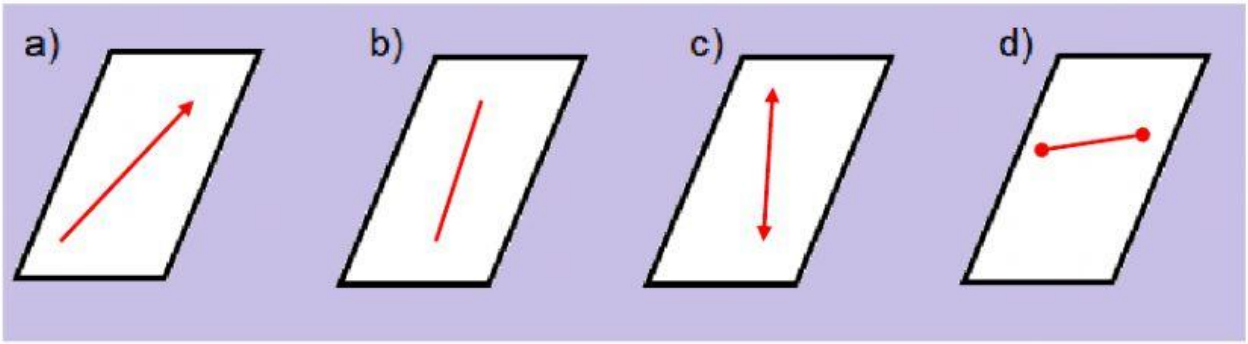

POFESORA: AILY MELISSA GUTARRA BONIFAZ

LIVEWORKSHEETS

4. ESCRIBE CORRECTAMENTE LOS NOMBRES DE LAS SIGUIENTES REGLAS:





5. ESCRIBE PARALELA O PERPENDICULAR DE A CUERDO AL CASO:

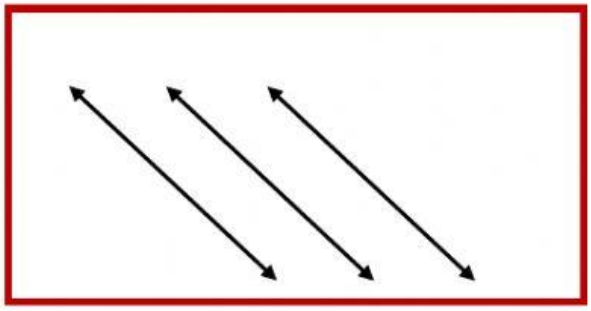

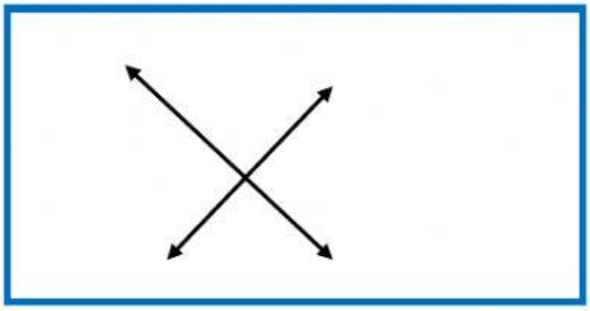

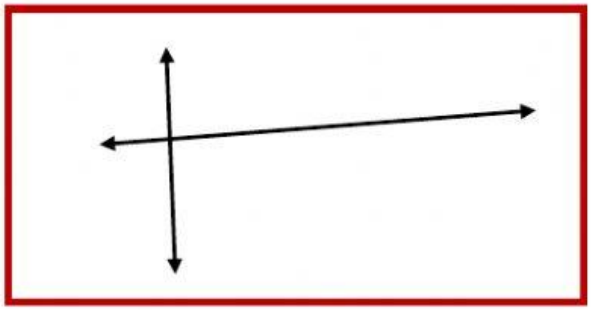

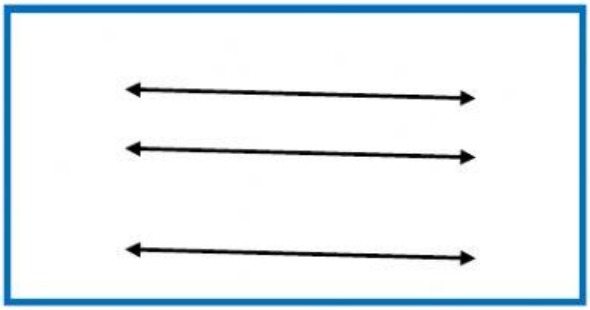

POFESORA: AILY MELISSA GUTARRA BONIFAZ

LIVEWORKSHEETS