Friday 30th April, 2021
Term 3
Weekly Test 2- Mathematics

A. Complete the addition and subtraction facts for number 16.

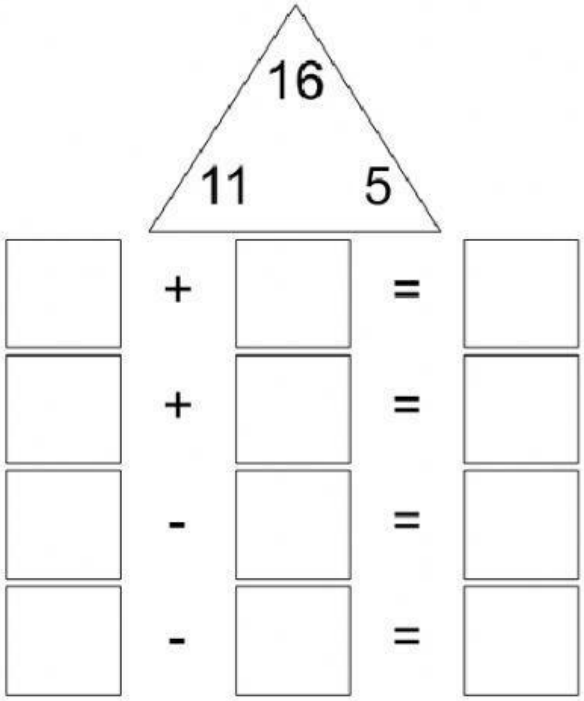

B. Fill in the missing money to make $16 in each wallet.

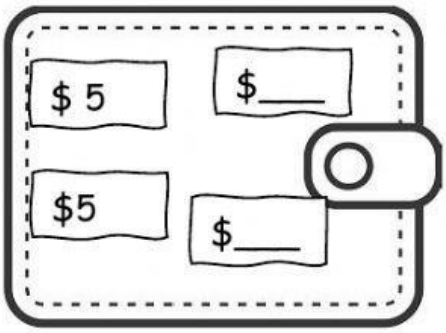

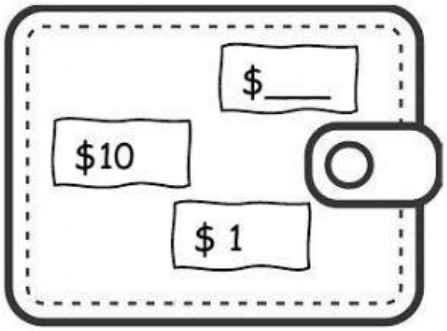

LIVEWORKSHEETS

C. Solve the word problems. Write your number statements.

NB: Do not put in the dollar signs on the online worksheet.

1.. Nicholai had **$16**.

He bought ice-cream for **$9**.

How much money was left?

_____

2. Kayla bought a pack of nuts for **$5**.

Mayah bought a pack of chips for **$9**.

Cataleya bought a pack of sweets for **$2**.

a. How much money they spent in all?

_____

b. Who spent the **most** money?

_____

c. How much more money did Mayah spend than Cataleya?

_____

Mayah spent $_____ more than Cataleya.

LIVEWORKSHEETS

D. Look at each scale and complete each sentence.

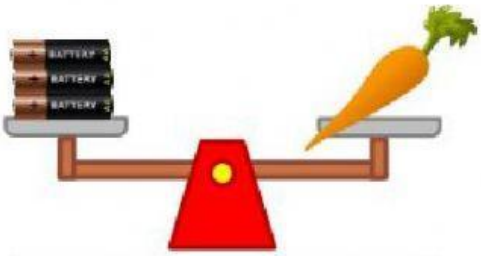

The weight of the carrot in batteries is _____.

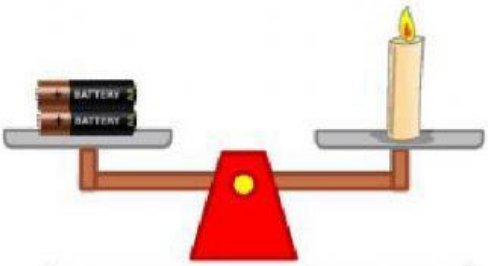

The weight of the candle in batteries is _____.

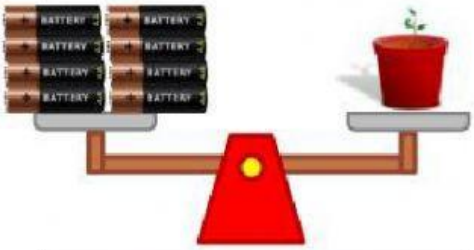

The weight of the plant in batteries is _____.

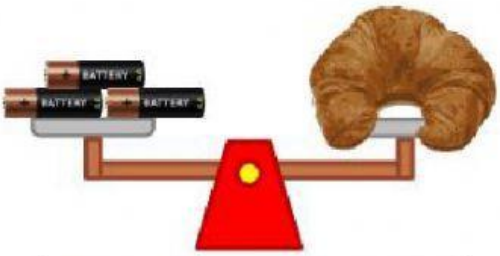

The weight of the croissant in batteries is _____.

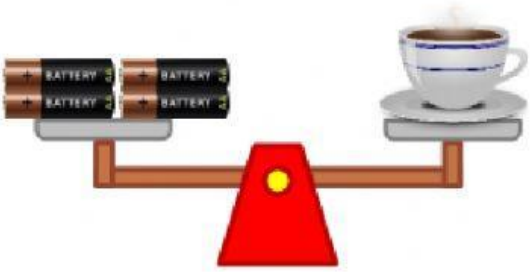

The weight of the coffee in batteries is _____.

Which object is the **heaviest**? _____

Which object is the **lightest**? _____

LIVEWORKSHEETS