Kalkulatu kaxa bakoitzaren pisua:











<u>Zuzendu zuk zeuk.</u>

Hona hemen erantzunak. Aztertu lortu dituzun emaitzak balio hauekin bat datozen.

500 g 1.000 g 1,25 kg 750 g 2,75 kg

LIVEWORKSHEETS