ÁREA DE LAS FIGURAS PLANAS

OPERACIONES

PERÍMETRO ____ cm2

ÁREA ____ cm2

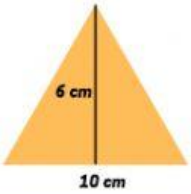

OPERACIONES

PERÍMETRO ____ cm2

ÁREA ____ cm2

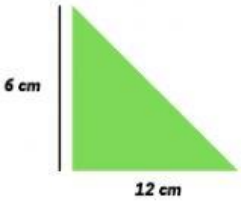

OPERACIONES

PERÍMETRO ____ cm2

ÁREA ____ cm2

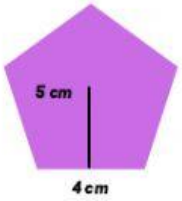

OPERACIONES

PERÍMETRO ____ cm2

ÁREA ____ cm2

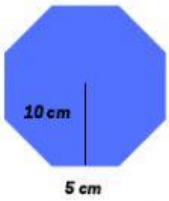

OPERACIONES

PERÍMETRO ____ cm2

ÁREA ____ cm2

OPERACIONES

PERÍMETRO ____ cm2

ÁREA ____ cm2



OPERACIONES

PERÍMETRO ____ cm2

ÁREA ____ cm2

LIVEWORKSHEETS
@pedagogiaymas