# Sólidos geométricos 2

1. Escreve o nome dos sólidos e relaciona cada um deles com a respetiva planificação.

| | | | |
|---|---|---|---|
| Paralelepípedo | Cubo | Pirâmide triangular | Prisma pentagonal |
| Pirâmide quadrangular | Cone | Prisma triangular | Cilindro |

_____ 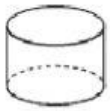 • • 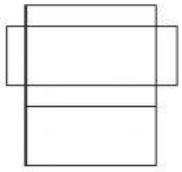

_____ 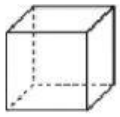 • • 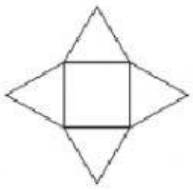

_____ 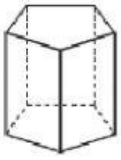 • • 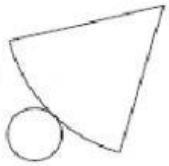

_____ 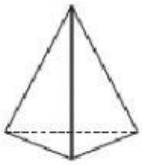 • • 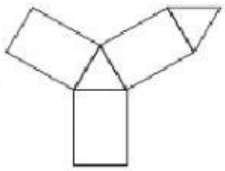

_____ 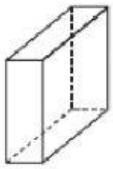 • • 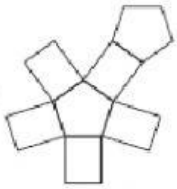

_____ • • 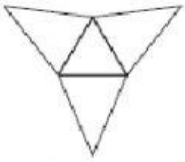

_____ • • 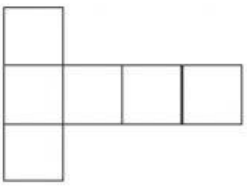

_____ 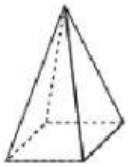 • • 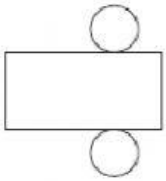

LIVEWORKSHEETS

2. Completa com nome do sólido respetivo:

| |
|---|
| cone |
| esfera |
| prisma retangular |
| pirâmide pentagonal |
| cubo |
| prisma hexagonal |
| pirâmide triangular |
| cilindro |

Tenho 6 vértices e 6 faces. Uma face é um pentágono e 5 faces são triangulares.

Sou o _____.

Tenho 8 vértices e 6 faces. Duas faces são quadradas e 4 faces são retângulos.

Sou o _____.

Tenho 8 vértices e 6 faces. As minhas faces são todas quadrados.

Sou o _____.

Tenho 4 vértices e 4 faces. As faces são todas triangulares

Sou o _____.

Tenho 1 só face circular.

Sou o _____.

Tenho 2 faces circulares.

Sou o _____.

Tenho 12 vértices e 8 faces. Duas faces são hexágonos e 6 faces são retângulos

Sou o _____.

Não tenho vértices, nem arestas, nem faces planas.

Sou o _____.

LIVEWORKSHEETS

3. A figura representa um sólido.

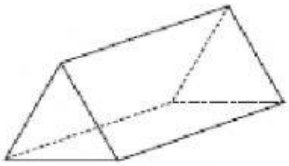

Em qual das opções estão representadas todas as faces do sólido? Seleciona a resposta correta.

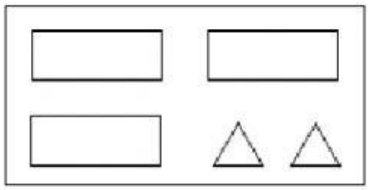

☐ Opção A

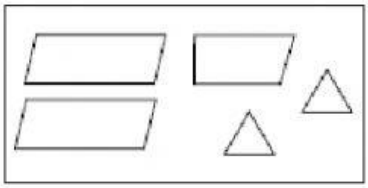

☐ Opção B

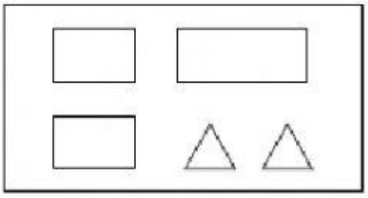

☐ Opção C

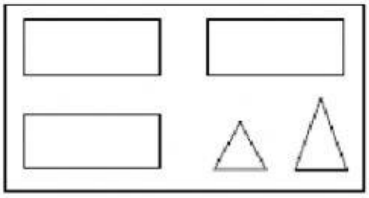

☐ Opção D

LIVEWORKSHEETS