NAME_____ DATE_____

# FORM 1 TERM III WEEK 3

## AREA WORKSHEET

Calculate the area of the figures.

1.




Area= _____$cm^2$

2.




Area= _____$mm^2$

3.

Area= _____$cm^2$

4.

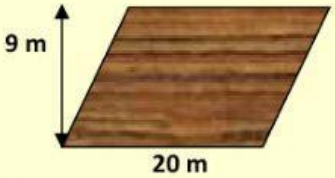


Area= _____$m^2$

5.

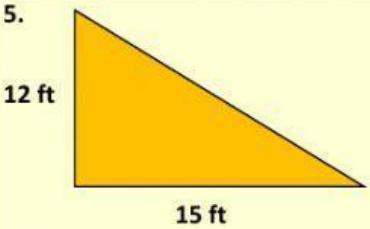


Area= _____$ft^2$

6.

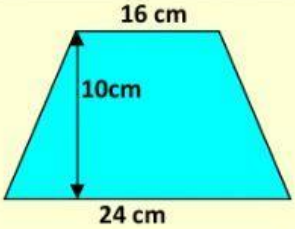


Area= _____$cm^2$

7.

Area = _____$mm^2$

8.




Area = _____$m^2$

9.

Area = _____$km^2$

Note:

**Area of square** = L × L

**Area of rectangle** = L × B

**Area of parallelogram** = Base × Height

10.

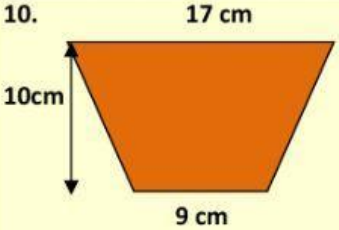


Area = _____$cm^2$

Note:

**Area of triangle** = ½ (b × h)

**Area of trapezium** = **½ (sum // sides) × height**

LIVEWORKSHEETS