NOME:

DATA: TURMA:

CONTANDO COM BALÕES

VAMOS CALCULAR?



TINHA	ESTOURARAM	SOBRARAM
10	2	

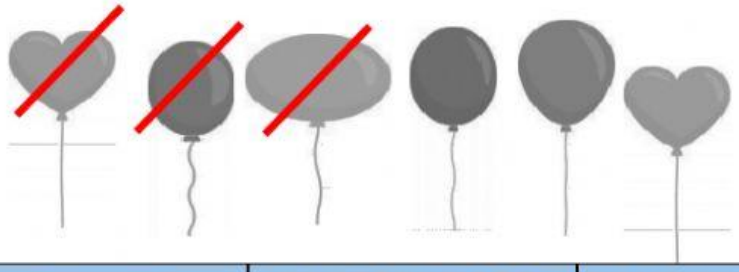

TINHA	ESTOURARAM	SOBRARAM



TINHA	ESTOURARAM	SOBRARAM

Prof. Suzana e Prof. Valéria

LIVEWORKSHEETS